Goa Staff Selection Commission

6th Floor, 3rd Lift, SPACES Building, Patto Plaza, Panaji-Goa – 403001.

No.1/164/2026-GSSC/1165 Dated: 26/11/2026

NOTICE

Advertisement No.3 of Year 2026

The Commission received grievances that some of the questions of the CBT held on 07.11.2026, 14.11.2026, 15.11.2026, 21.11.2026 & 22.11.2026 depicting pictures etc are not visible after downloading the pdf version through the portal.

The questions are reproduced batch wise/ day wise below. The candidates are allowed to raise grievance, if any, only against these questions/ answer keys by 27th November, 2026, by following the revised instructions on grievances as available on the website.

The candidates are not allowed to raise grievance, on other questions by 27th November, 2026.

Date	07/11/2026
Exam Time	09:15 AM TO 10:30 PM

Qno.	41
Question	Identify the figure that completes the pattern 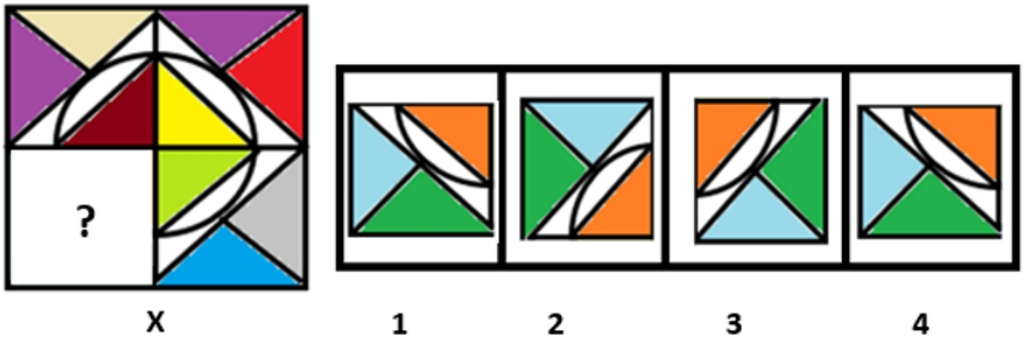
A	1
B	2
C	3
D	4
E	None of the above
Answer	A
Marks	1

Qno	42
Question	Identify the option that will complete the figure given below. 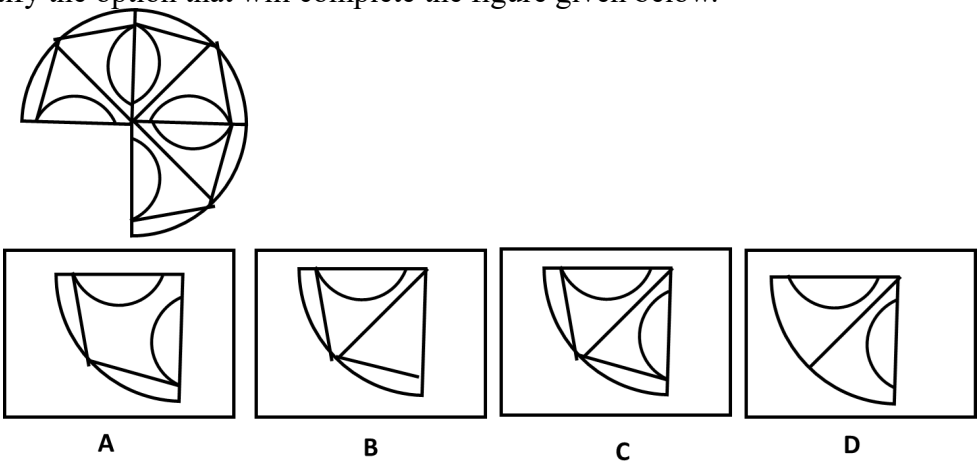
A	A
B	B
C	C
D	D
E	None of the above
Answer	C
Marks	1

Qno	43
Question	Find the number of triangles in the given figure. 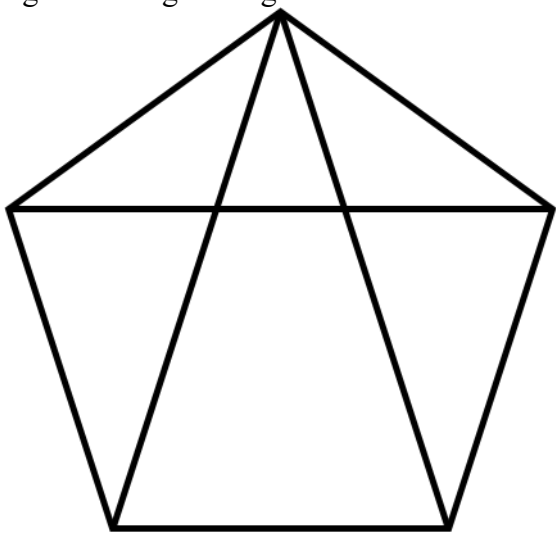
A	10
B	11
C	9
D	14
E	None of the above
Answer	B
Marks	1

Qno	44
Question	Choose the figure that is different from the rest. 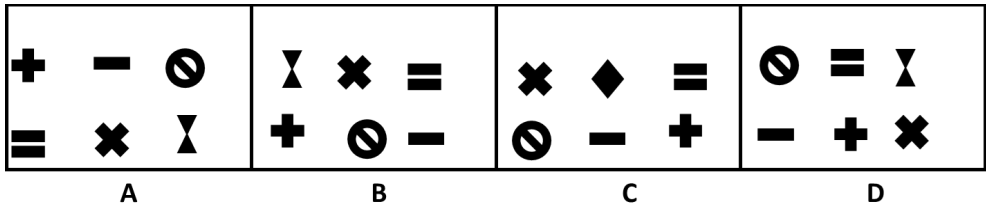
A	A
B	B
C	C
D	D
E	None of the above
Answer	C
Marks	1

Qno	45
Questionl.	Find the alternative figure which contain figure X as its part 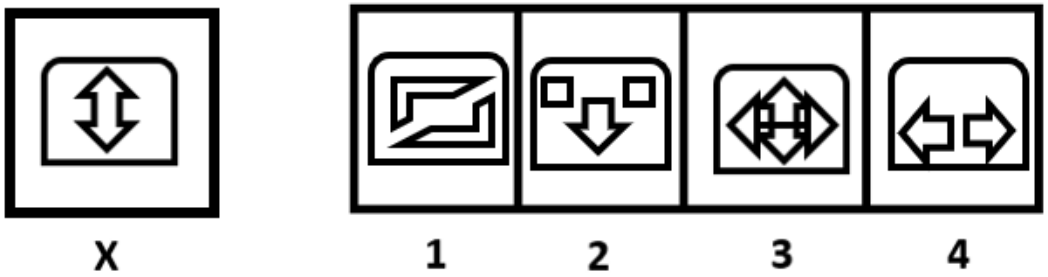
A	1
B	2
C	3
D	4
E	None of the above
Answer	C
Marks	1

Qno	46
Question	Group the given figures into three classes using each figure only once. 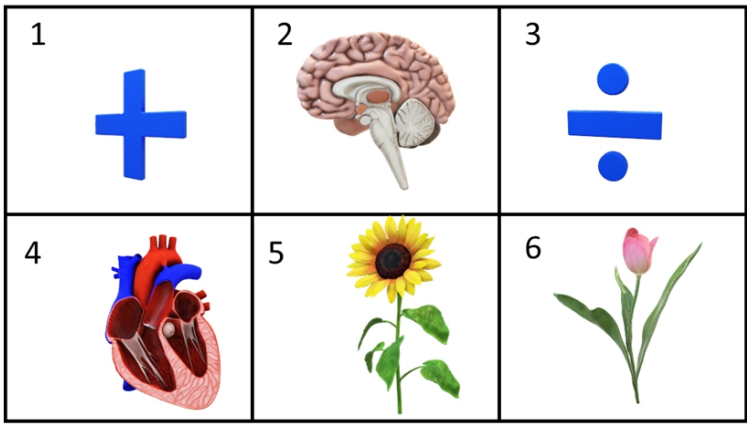
A	(1,2), (3,4), (5,6)
B	(1,5), (2,6), (3,4)
C	(1,4), (2,5), (3,6)
D	(1,3), (2,4), (5,6)
E	None of the above
Answer	D
Marks	1

Qno	47
Question	Choose a figure which would most closely resemble the unfolded form of Figure (Y). 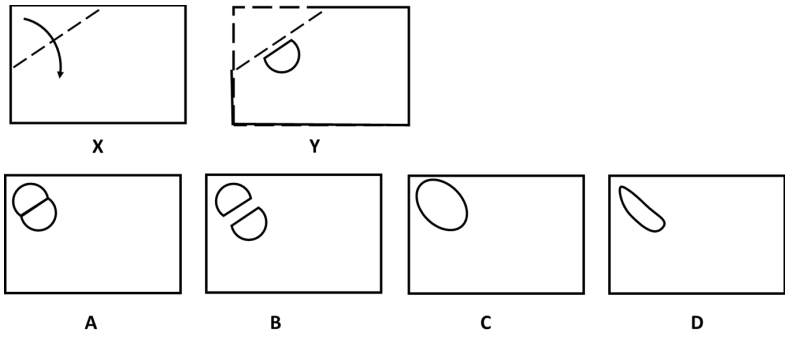
A	A
B	B
C	C
D	D
E	None of the above
Answer	B
Marks	1

Qno	48
Question2.	Find out which of the following figures (1), (2), (3), (4) can be formed from the pieces given in the figure 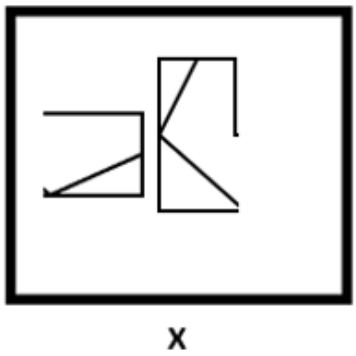 X 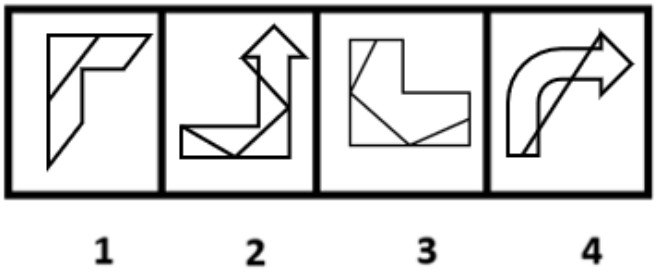 1 2 3 4
A	1
B	2
C	3
D	4
E	None of the above
Answer	C
Marks	1

Qno	49
Question3.	The question below consists of two set of figures. Figures A,B,C,D constitutes problem set while figures 1,2,3,4 constitute answer set . There is definite relationship between figures A and B. Establish a suitable relationship between figures C and D by Selecting a suitable figure from the Answer Figures that would replace the question mark (?). 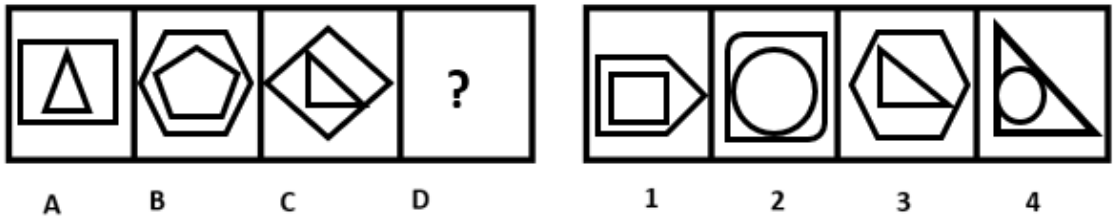
A	1
B	2
C	3
D	4
E	None of the above
Answer	A
Marks	1

Qno	50
Question	Choose the correct option that closely resemble the mirror image of the following image. 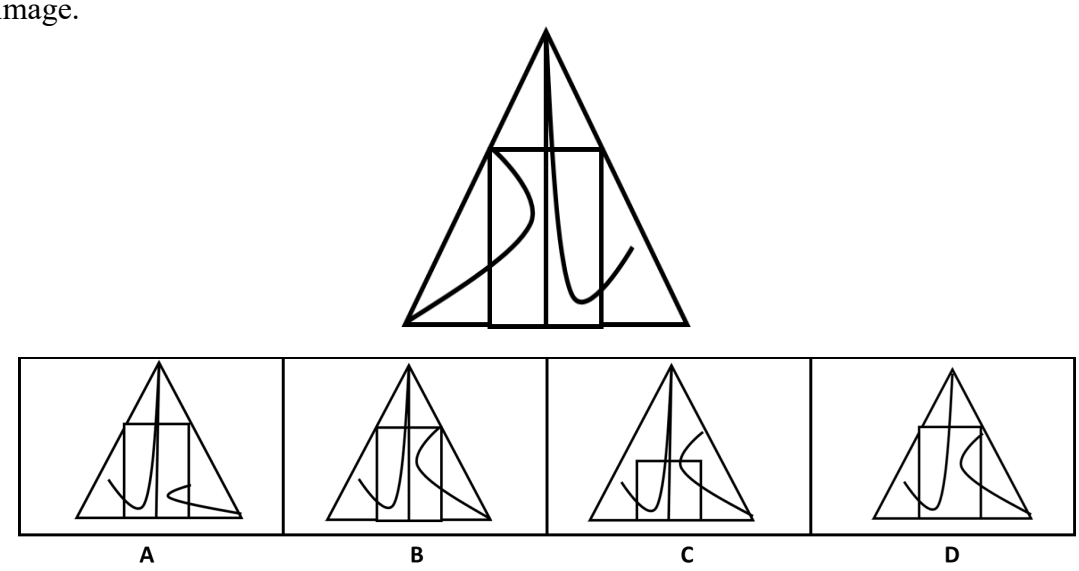
A	A
B	B
C	C
D	D
E	None of the above
Answer	B
Marks	1

Date	07/11/2026
Exam Time	11:30 AM TO 12:45 PM
Qno.	41
Question	Select a suitable figure from the answer figures that will establish the similar relationship between figures 3 and 4 as the one observed between figure 1 and 2. Question Figure 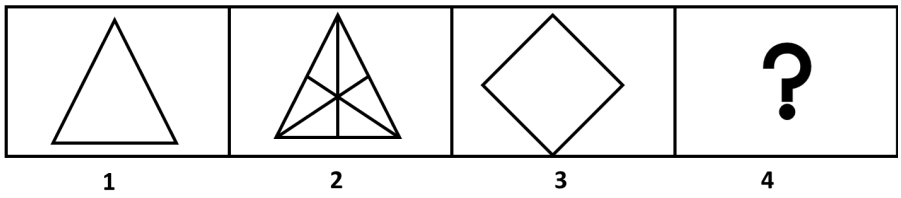 Answer Figures 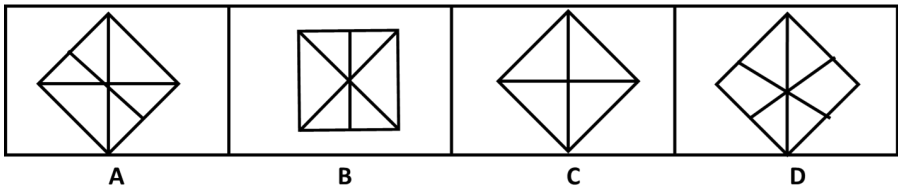
A	A
B	B
C	C
D	D
E	None of the above
Answer	D
Marks	1

Qno	42
Question	Select a suitable figure from the four alternatives that would complete the figure matrix. 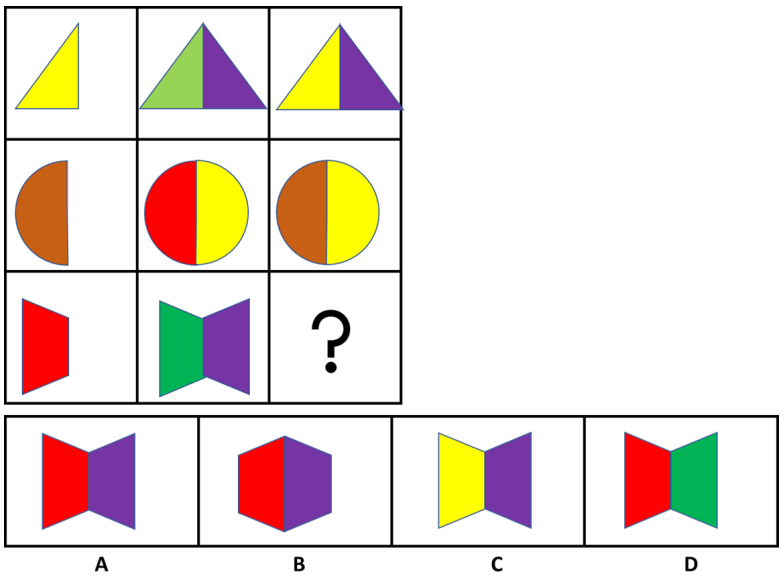
A	A
B	B
C	C
D	D
E	None of the above
Answer	A
Marks	1

Qno	43
Questionl.	In how many equal parts each of the circle in the given figure is divided? 
A	7
B	8
C	10
D	12
E	None of the above
Answer	B
Marks	1

Qno	44
Question2.	Choose the letter which is different from the rest 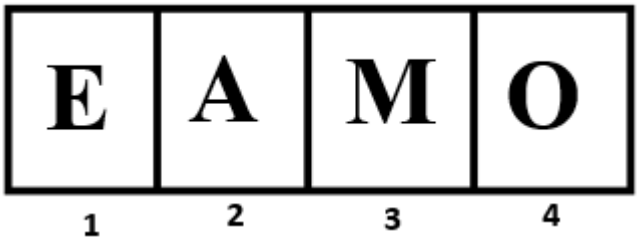
A	1
B	2
C	3
D	4
E	None of the above
Answer	C
Marks	1

Qno.	45
Question	Find out the alternative figure which contains figure (X) as its part. 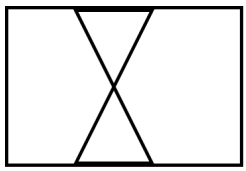 X  A B C D
A	A
B	B
C	C
D	D
E	None of the above
Answer	D
Marks	1

Qno	46
Question3.	Group the given figure into three classes using each figure only once 
A	1,4,7;2,5,8;3,6,9
B	1,5,9;2,3,4;6,7,8
C	1,7,9;2,3,4;5,6,8
D	1,2,3;4,5,6;7,8,9
E	None of the above
Answer	C
Marks	1

Qno	47
Question	A circular sheet of paper is folded and cut as shown below. How it will appear when opened?. Choose the correct option. 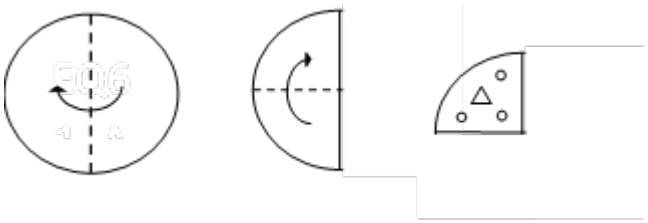
A	
B	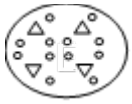
C	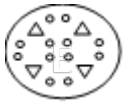
D	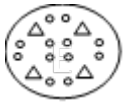
E	None of the above
Answer	C
Marks	1

Qno	48
Question	Find out which of the figures (1), (2), (3) and (4) can be formed from the pieces given in figure (X). 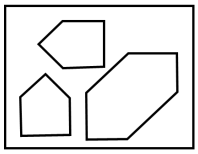 X 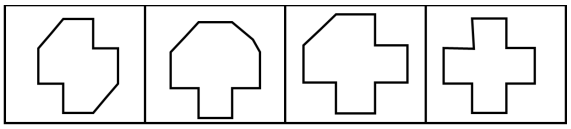 1 2 3 4
A	1
B	2
C	3
D	4
E	None of the above
Answer	C
Marks	1

Qno	49
Question	Find the figure from the answer set **(1,2,3,4)** which will continue series given in the problem set **(A, B, C, D)** 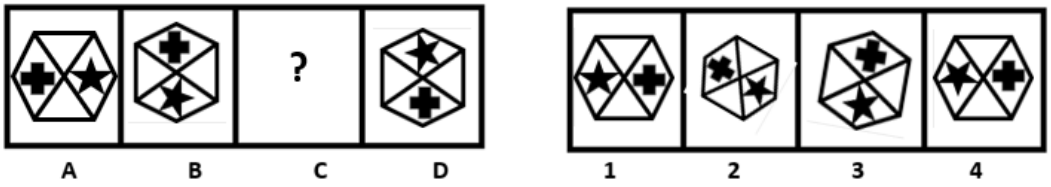
A	1
B	2
C	3
D	4
E	None of the above
Answer	D
Marks	1

Qno	50
Question	Choose the alternative which closely resembles the mirror image of the given combination. MALAYALAM
A	MALAYALAM
B	MALAYALAM
C	MALAYALAM
D	MALAYALAM
E	None of the above
Answer	B
Marks	1

Date	07/11/2026
Time	02:00 PM TO 03:15 PM
Qno.	41
Question	Select a suitable figure from the answer figures that will establish the similar relationship between figures 3 and 4 as the one observed between figure 1 and 2. Question Figure 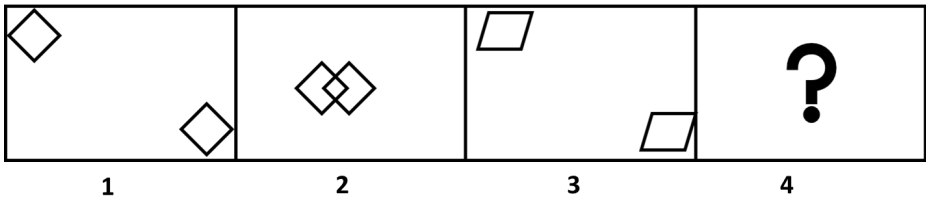 Answer Figures 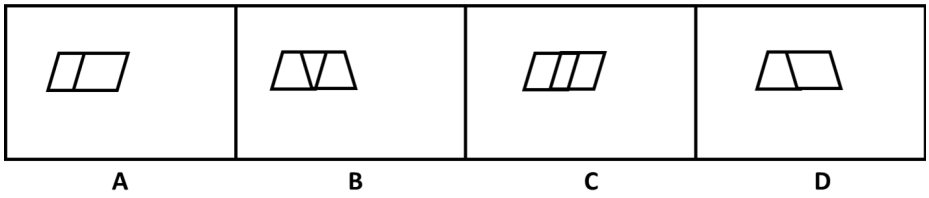
A	A
B	B
C	C
D	D
E	None of the above
Answer	C
Marks	1

Qno.	42
Question	Find out the alternative figure that contain figure X as its part. 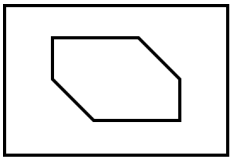 X 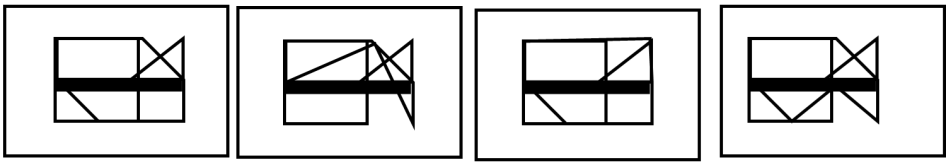 A B C D
A	A
B	B
C	C
D	D
E	None of the above
Answer	A
Marks	1

Qno.	43
Questionl.	Find the number of right-angled triangle present in the given figure 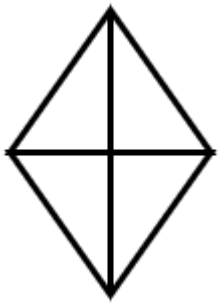
A	1
B	2
C	3
D	4
E	None of the above
Answer	D
Marks	1

Qno.	44
Question	Choose the figure that is different from the rest. 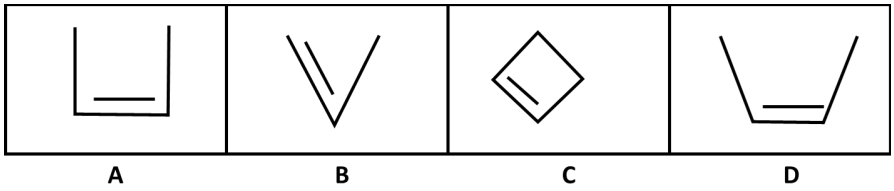
A	A
B	B
C	C
D	D
E	None of the above
Answer	C
Marks	1

Qno.	45
Question	Find out the alternative figure that contain figure X as its part.  X 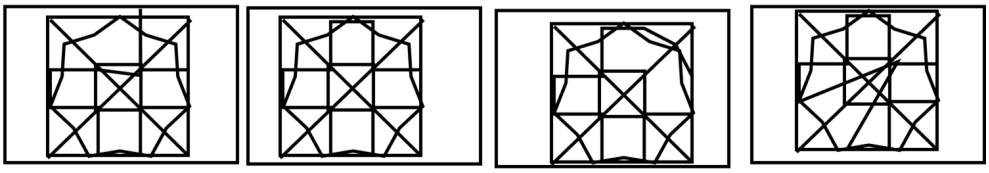 A B C D
A	A
B	B
C	C
D	D
E	None of the above
Answer	B
Marks	1

Qno.	46
Question2.	Group the given figure into three classes using each figure only once 
A	1,2,3;4,5,6;7,8,9
B	1,4,7;2,5,8;3,6,9
C	1,5,9;2,3,4;6,7,8
D	1,3,5;2,4,6,7,8,9
E	None of the above
Answer	C
Marks	1

Qno.	47
Question	Choose a figure which would most closely resemble the unfolded form of Figure (Y). 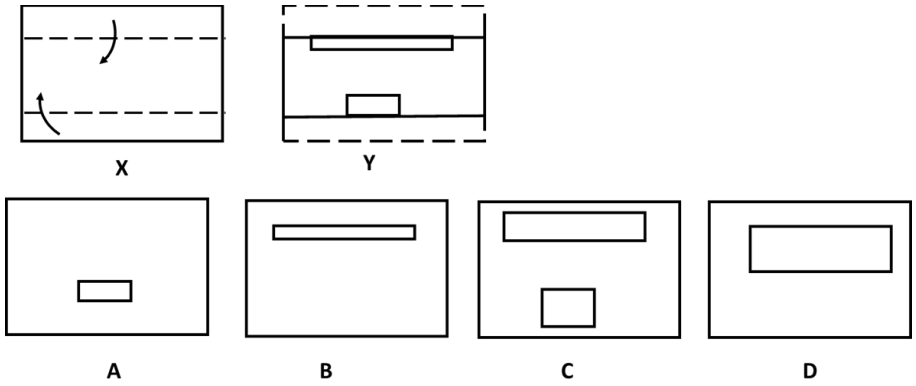
A	A
B	B
C	C
D	D
E	None of the above
Answer	C
Marks	1

Qno.	48
Question	Select the alternative which represents three out of the five alternative figures which when fitted into each other would form a complete Square. 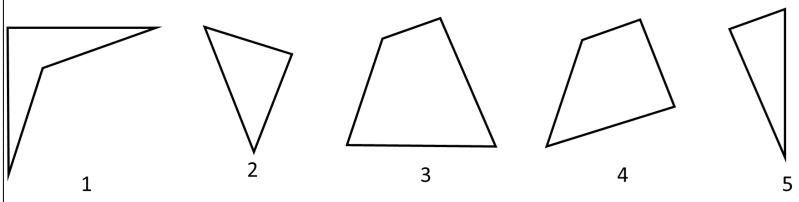
A	2, 3, 5
B	3, 4, 5
C	1, 3, 5
D	1, 3, 4
E	None of the above
Answer	C
Marks	1

Qno.	49
Question3.	The question below consists of two set of figures. Figures A,B,C,D constitutes problem set while figures 1,2,3,4, constitute answer set . There is definite relationship between figures A and B. Establish a suitable relationship between figures C and D by Selecting a suitable figure from the Answer Figures that would replace the question mark (?). 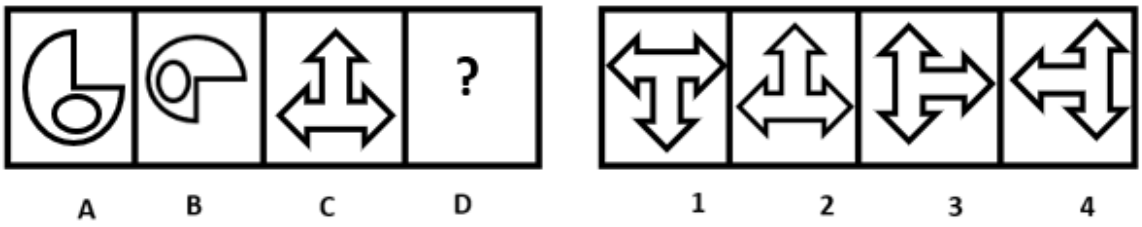
A	1
B	2
C	3
D	4
E	None of the above
Answer	C
Marks	1

Qno.	50
Question	Choose the correct option that closely resembles the water image of the following figure 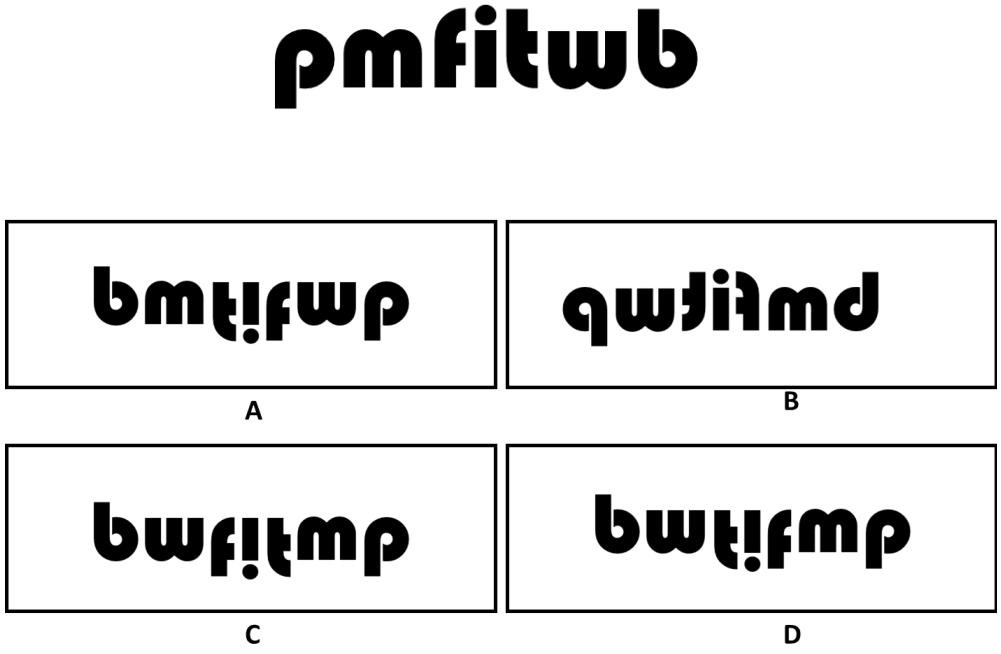
A	A
B	B
C	C
D	D
E	None of the above
Answer	D
Marks	1

Date	07/11/2026
Exam time	04:15 PM TO 05:30 PM
Qno.	41
Question	Select a suitable figure from the answer figures that will establish the similar relationship between figures 3 and 4 as the one observed between figure 1 and 2. Question Figure 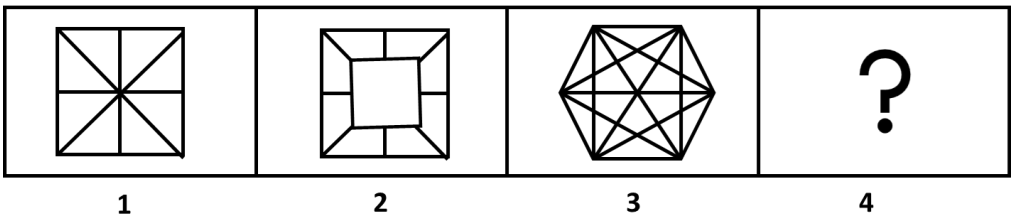 Answer Figures 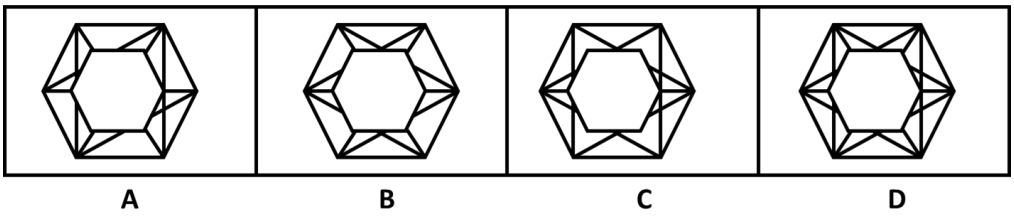
A	A
B	B
C	C
D	D
E	None of the above
Answer	D
Marks	1

Qno.	42
Question	Select a suitable figure from the four alternatives that would complete the figure matrix. 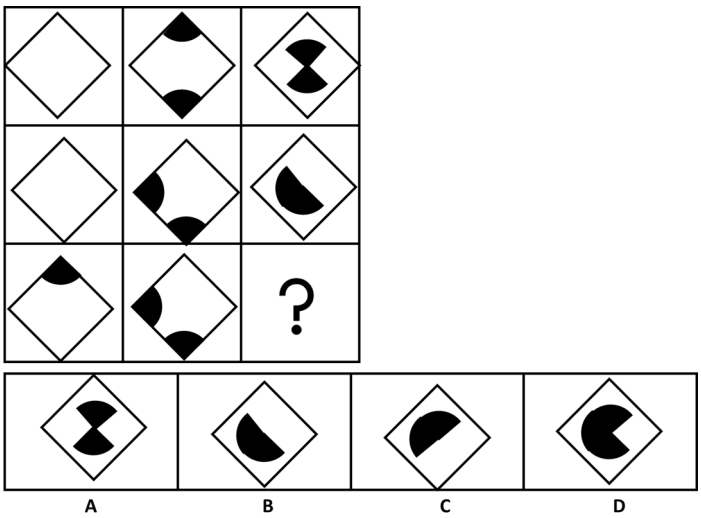
A	A
B	B
C	C
D	D
E	None of the above
Answer	D
Marks	1

Qno.	43
Questionl.	Find number of triangles in the figure given below 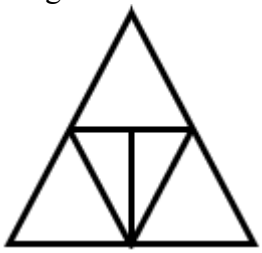
A	5
B	6
C	7
D	8
E	None of the above
Answer	C
Marks	1

Qno.	44
Question	Choose the figure that is different from the rest. 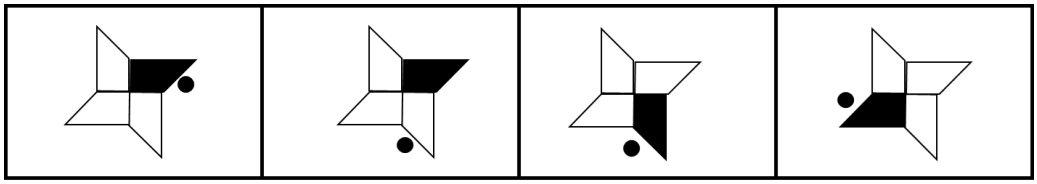
A	A
B	B
C	C
D	D
E	None of the above
Answer	B
Marks	1

Qno.	45
Question	Find the alternative figure which contain figure X as its part 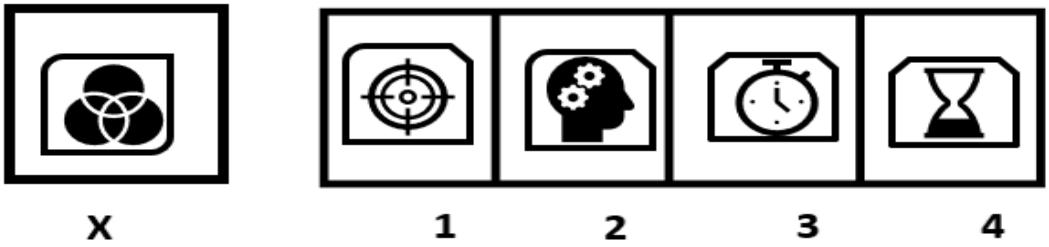
A	1
B	2
C	3
D	4
E	None of the above
Answer	E
Marks	1

Qno.	46
Question	Group the given figures into three classes using each figure only once. 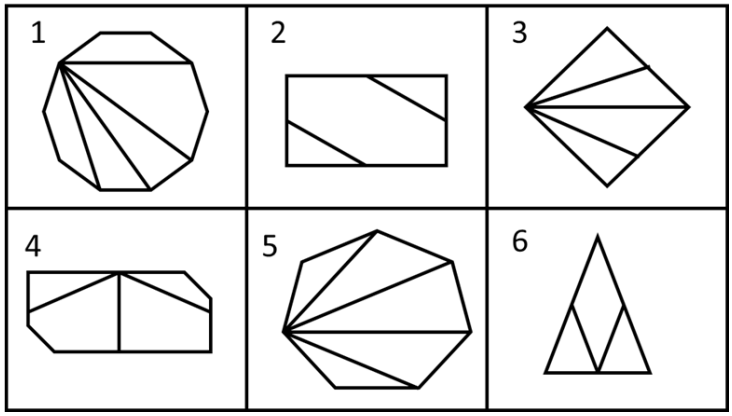
A	(1,5), (2,6), (3,4)
B	(4,5), (1,6), (3,2)
C	(1,5), (6,3), (3,2)
D	(1,2), (3,5), (4,6)
E	None of the above
Answer	A
Marks	1

Qno.	47
Question	Find out from amongst the four alternatives as to how the pattern would appear when the transparent sheet is folded at the dotted line in the direction of the arrow shown. 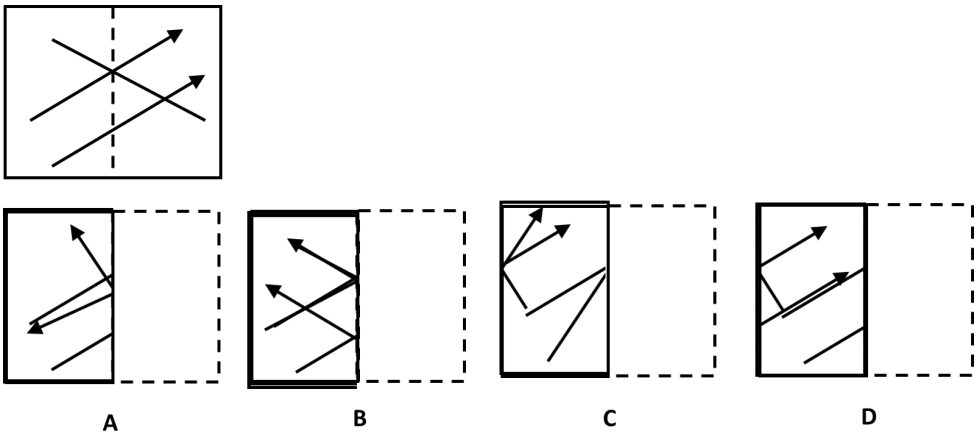
A	A
B	B
C	C
D	D
E	None of the above
Answer	B
Marks	1

Qno.	48
Question	Select the alternative which represents three out of the five alternative figures which when fitted into each other would form a complete Square. 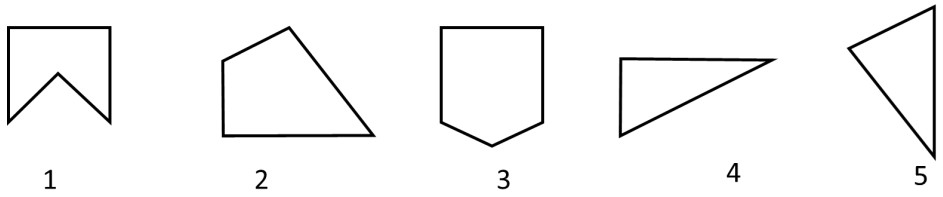
A	5, 2, 4
B	1, 3, 5
C	3, 4, 2
D	1, 2, 5
E	None of the above
Answer	A
Marks	1

Qno.	49
Question2.	Find the figure from the answer set **(1,2,3,4)** which will continue series given in the problem set **(A, B, C, D)** 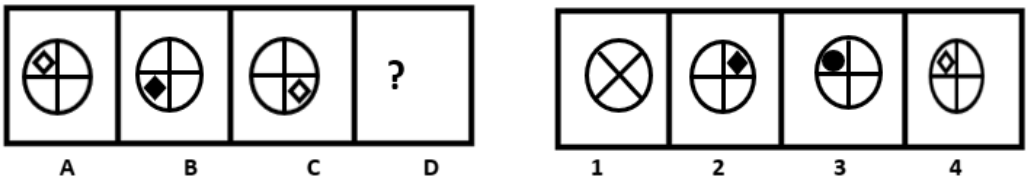
A	1
B	2
C	3
D	4
E	None of the above
Answer	B
Marks	1

Qno.	50
Question	Choose the correct option that closely resembles the mirror image of the following figure. 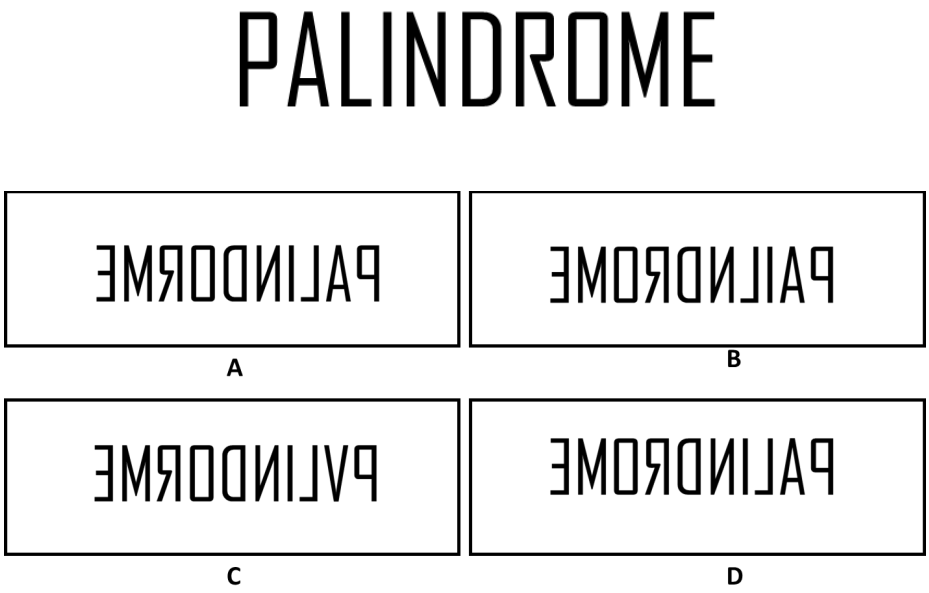 A B C D
A	A
B	B
C	C
D	D
E	None of the above
Answer	D
Marks	1

Date	14/11/2026
Exam Time	09:15 AM TO 10:30 PM
Qno.	41
Questionl.	Identify the figure that completes the pattern 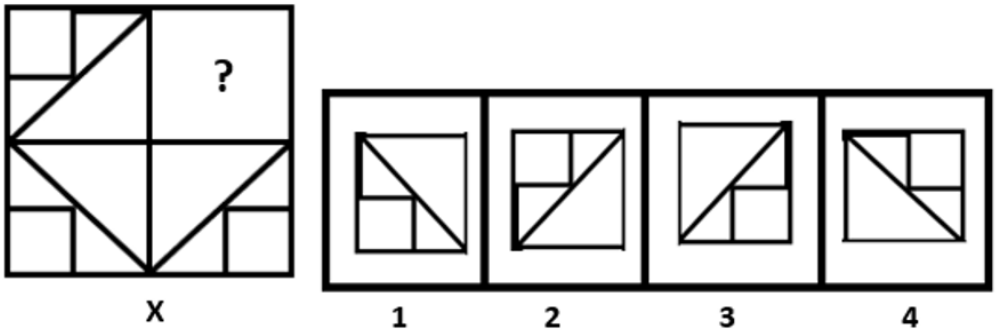
A	1
B	2
C	3
D	4
E	None of the above
Answer	D
Marks	1

Qno.	42
Question	Select a suitable figure from the four alternatives that would complete the figure matrix.  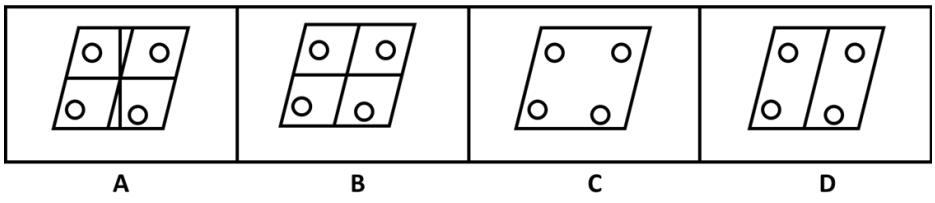 A B C D
A	A
B	B
C	C
D	D
E	None of the above
Answer	A
Marks	1

Qno.	43
Question	Find the minimum number of straight lines required to create the figure given in the following box. 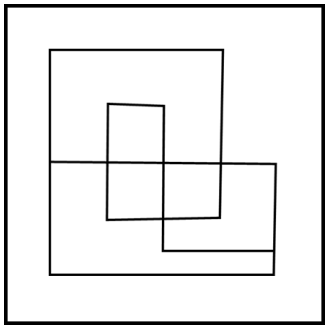
A	11
B	10
C	20
D	9
E	None of the above
Answer	A
Marks	1

Qno.	44
Question2.	Choose the figure which is different from the rest 
A	1
B	2
C	3
D	4
E	None of the above
Answer	D
Marks	1

Qno.	45
Question3.	Find the alternative figure which contain figure X as its part 
A	1
B	2
C	3
D	4
E	None of the above
Answer	D
Marks	1

Qno.	46
Question	4. Group the given figure into three classes using each figure only once 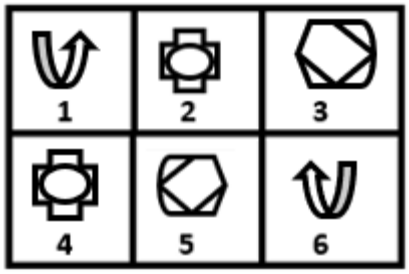
A	1,6;2,4;3,5
B	1,5;2,6;3,4
C	1,3;2,5;3,4
D	1,4;2,3;5,6
E	None of the above
Answer	A
Marks	1

Qno.	47
Question	Find out from amongst the four alternatives as to how the pattern would appear when the transparent sheet is folded at the dotted line in the direction of the arrow shown. 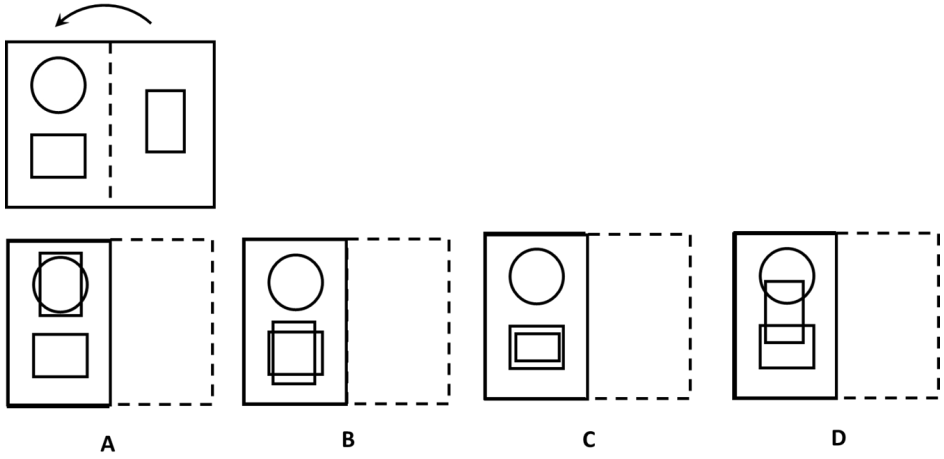
A	A
B	B
C	C
D	D
E	None of the above
Answer	D
Marks	1

Qno.	48
Question	Find out which of the figures (1), (2), (3) and (4) can be formed from the pieces given in figure (X). 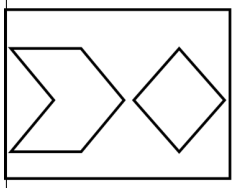 X 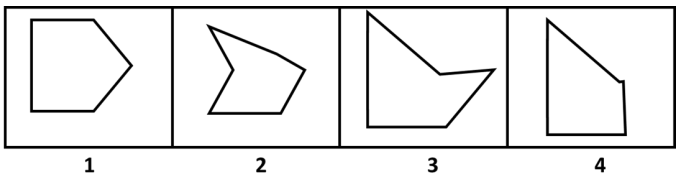 1 2 3 4
A	1
B	2
C	3
D	4
E	None of the above
Answer	E
Marks	1

Qno.	49
Question.	Find the figure from the answer set **(1,2,3,4)** which will continue series given in the problem set **(A, B, C, D)** 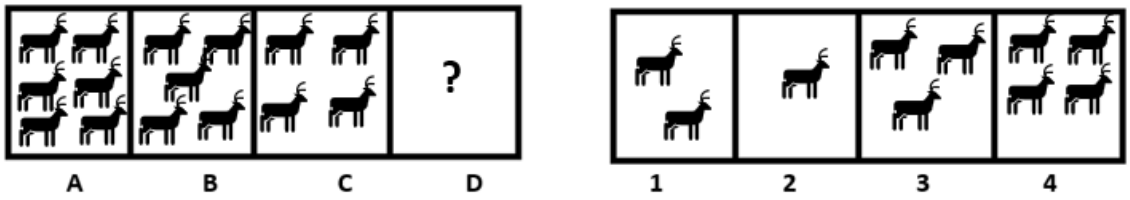
A	1
B	2
C	3
D	4
E	None of the above
Answer	C
Marks	1

Qno.	50
Question	Choose the alternative which closely resembles the mirror image of the given combination. 
A	
B	
C	
D	
E	None of the above
Answer	D
Marks	1

Date	14/11/2026
Exam Time	11:30 AM TO 12:45 PM
Qno.	41
Questionl.	Identify the figure that completes the pattern 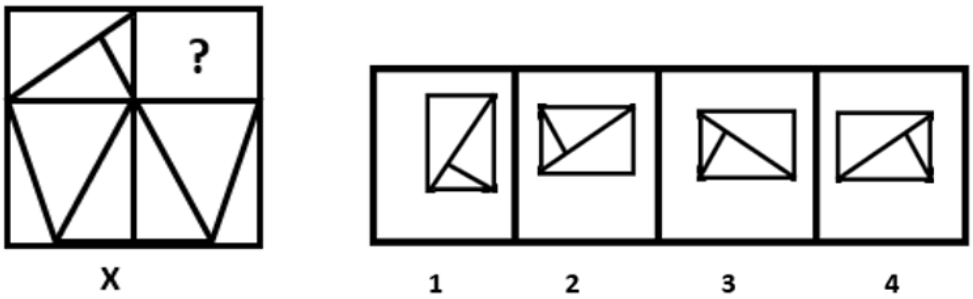
A	1
B	2
C	3
D	4
E	None of the above
Answer	C
Marks	1

Qno.	42
Question	Identify the option that will complete the figure given below. 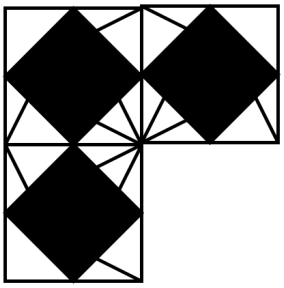 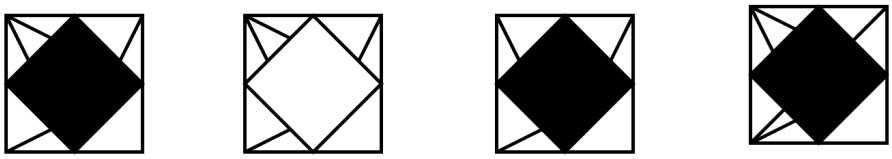 A B C D
A	A
B	B
C	C
D	D
E	None of the above
Answer	A
Marks	1

Qno.	43
Question2.	The number circles in the given figure is ? 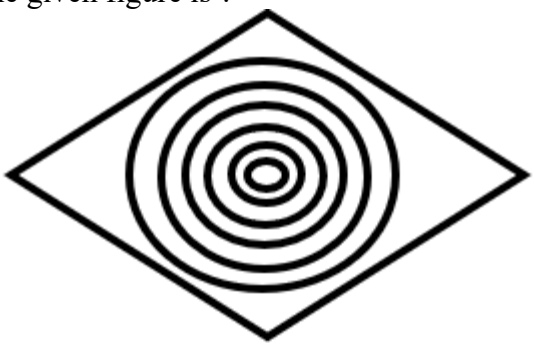
A	6
B	7
C	8
D	9
E	None of the above
Answer	A
Marks	1

Qno.	44
Question	Choose the figure that is different from rest. 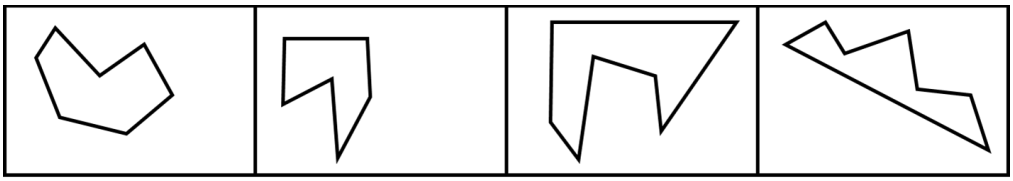
A	A
B	B
C	C
D	D
E	None of the above
Answer	B
Marks	1

Qno.	45
Question3.	Find the alternative figure which contains figure X as its part 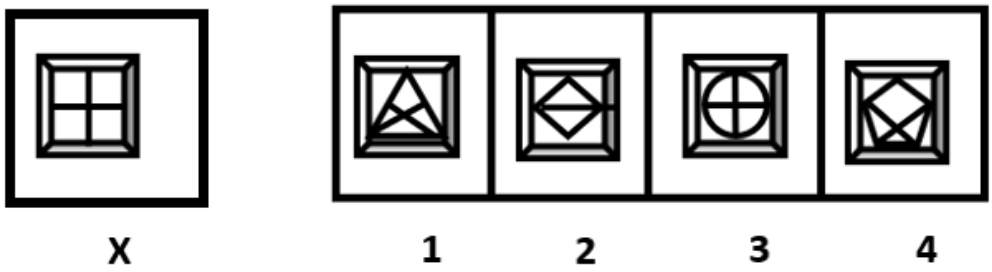
A	1
B	2
C	3
D	4
E	None of the above
Answer	C
Marks	1

Qno.	46
Question	Group the given figures into three classes using each figure only once. 
A	(1,5), (2,6), (3,4)
B	(4,6), (1,3), (5,2)
C	(1,5), (6,2), (3,4)
D	(1,2), (3,5), (4,6)
E	None of the above
Answer	B
Marks	1

Qno.	47
Question	Choose a figure which would most closely resemble the unfolded form of Figure (Y). 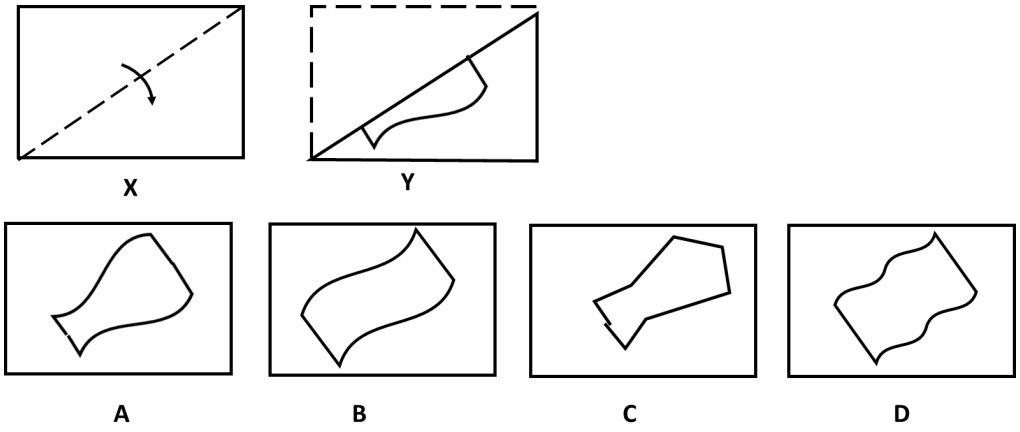
A	A
B	B
C	C
D	D
E	None of the above
Answer	A
Marks	1

Qno.	48
Question	Select the alternative which represents three out of the five alternative figures which when fitted into each other would form a complete Square. 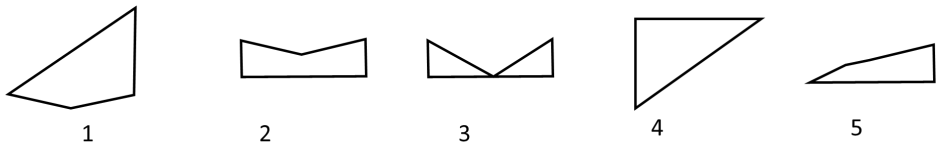
A	5, 2, 1
B	1, 3, 2
C	3, 4, 5
D	1, 2, 4
E	None of the above
Answer	D
Marks	1

Qno.	49
Question	The question below consists of two set of figures. Figures A,B,C,D constitutes problem set while figures 1,2,3,4 constitute answer set . There is definite relationship between figures A and B. Establish a suitable relationship between figures C and D by Selecting a suitable figure from the Answer Figures that would replace the question mark (?). 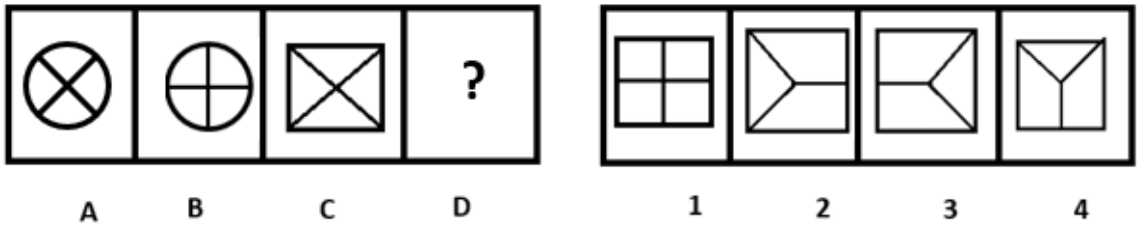
A	1
B	2
C	3
D	4
E	None of the above
Answer	A
Marks	1

Qno.	50
Question	Choose the correct option that closely resembles the water image of the following figure. 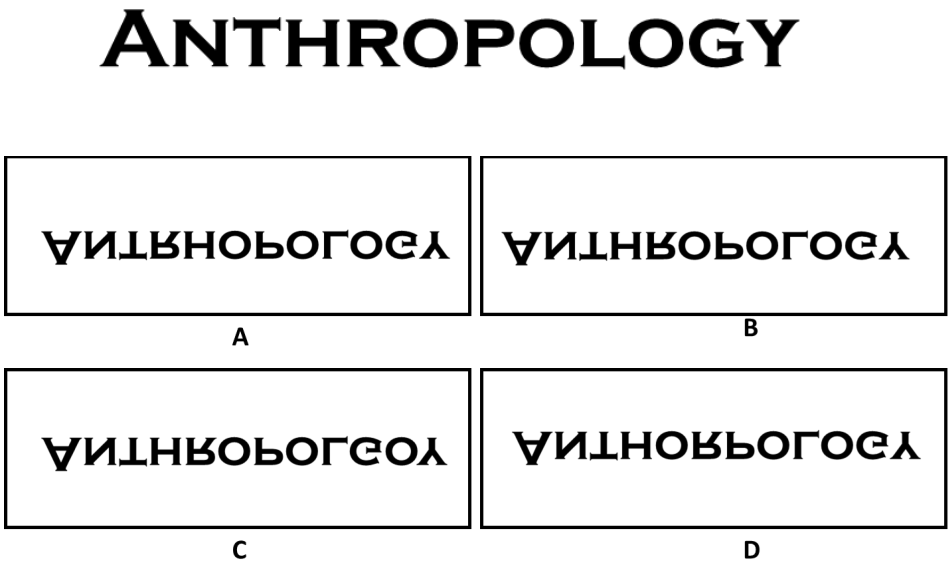
A	A
B	B
C	C
D	D
E	None of the above
Answer	B
Marks	1

Date	14/11/2026
Exam Time	02:00 PM TO 03:15 PM
Qno.	41
Question	Identify the option that will complete the figure given below. 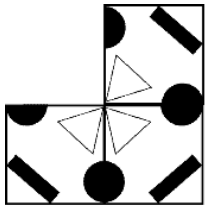 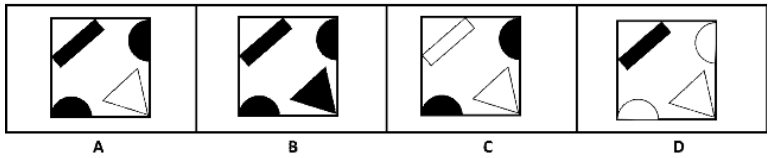
A	A
B	B
C	C
D	D
E	None of the above
Answer	A
Marks	1

Qno	42
Question	Select a suitable figure from the four alternatives that would complete the figure matrix. 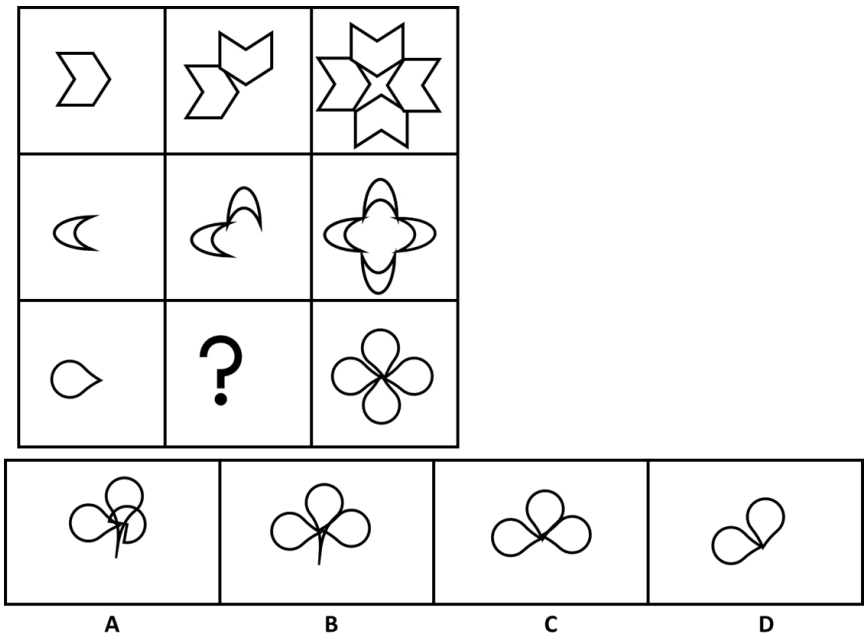
A	A
B	B
C	C
D	D
E	None of the above
Answer	D
Marks	1

Qno	43
Questionl.	Choose the letter which is different from the rest 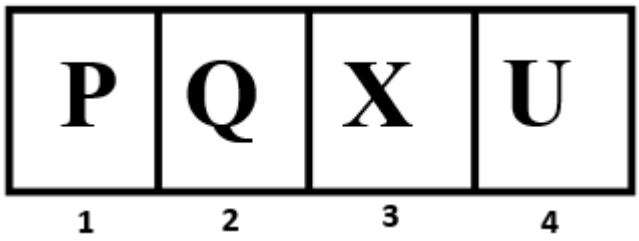
A	1
B	2
C	3
D	4
E	None of the above
Answer	D
Marks	1

Qno	44
Question	Choose the figure which is different from the rest 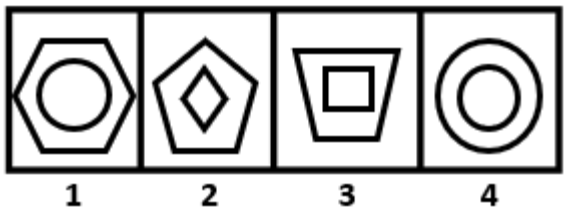
A	1
B	2
C	3
D	4
E	None of the above
Answer	D
Marks	1

Qno	45
Question2.	Find the alternative figure which contain figure X as its part 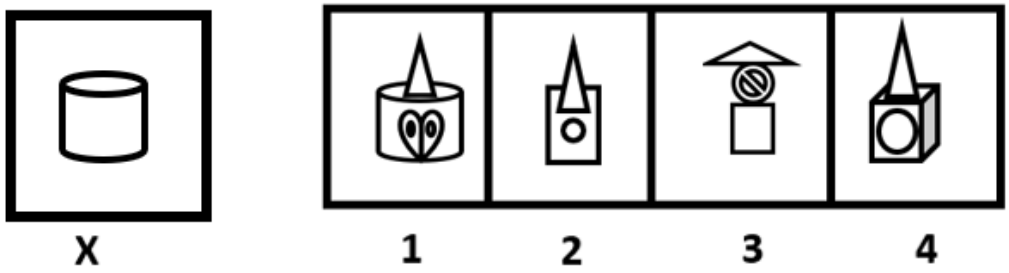
A	1
B	2
C	3
D	4
E	None of the above
Answer	A
Marks	1

Qno	46
Question	Group the given figures into three classes using each figure only once. 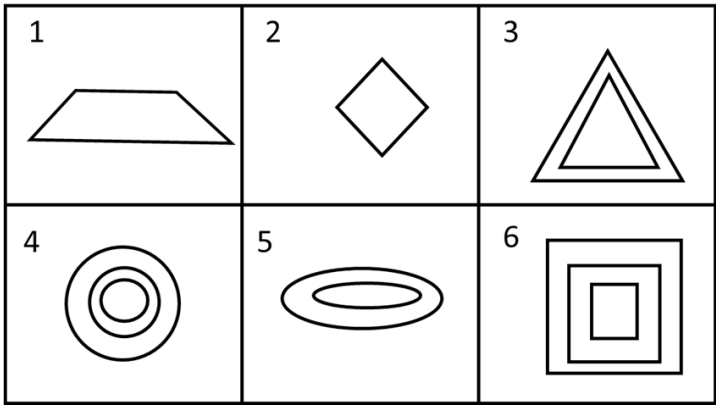
A	(1,5), (2,6), (3,4)
B	(4,5), (1,6), (3,2)
C	(1,5), (6,2), (3,4)
D	(1,2), (3,5), (4,6)
E	None of the above
Answer	D
Marks	1

Qno	47
Question	Find out from amongst the four alternatives as to how the pattern would appear when the transparent sheet is folded at the dotted line in the direction of the arrow shown. 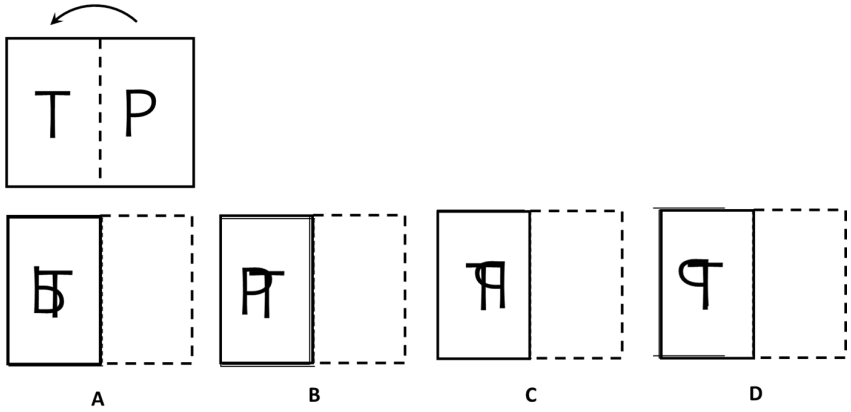
A	A
B	B
C	C
D	D
E	None of the above
Answer	C
Marks	1

Qno	48
Question	Find out which of the figures (1), (2), (3) and (4) can be formed from the pieces given in figure (X). 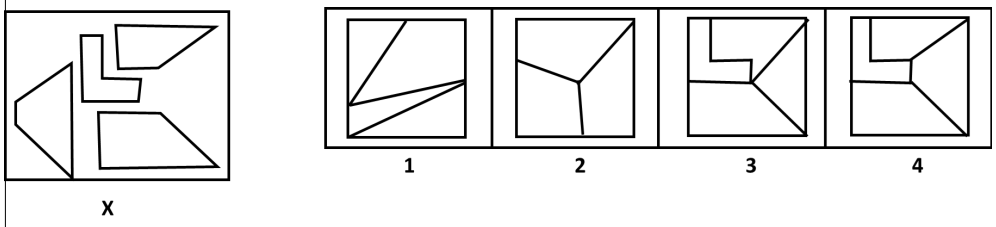
A	1
B	2
C	3
D	4
E	None of the above
Answer	D
Marks	1

Qno	49
Question	The question below consists of two set of figures. Figures A,B,C,D constitutes problem set while figures 1,2,3,4,constitute answer set . There is definite relationship between figures A and B. Establish a suitable relationship between figures C and D by Selecting a suitable figure from the Answer Figures that would replace the question mark (?). 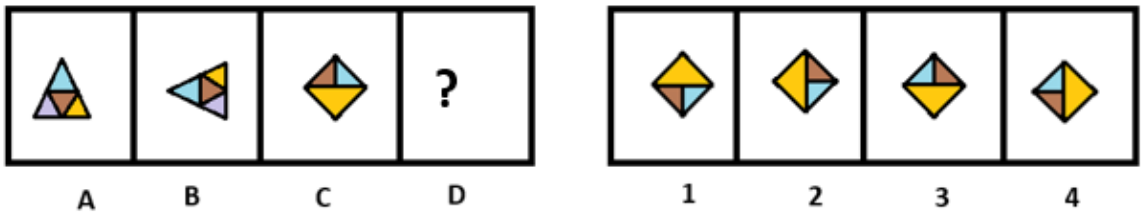
A	1
B	2
C	3
D	4
E	None of the above
Answer	D
Marks	1

Qno	50
Question	Choose the correct option that closely resembles the water image of the following figure. 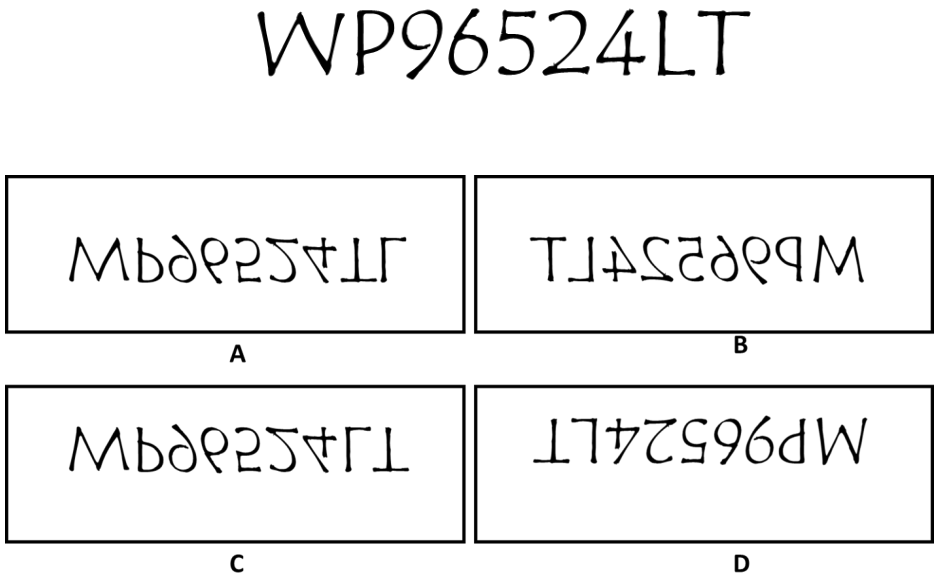
A	A
B	B
C	C
D	D
E	None of the above
Answer	C
Marks	1

Date	14/11/2026
Exam Time	04:15 PM TO 05:30 PM
Qno.	41
Question	Select a suitable figure from the answer figures that will establish the similar relationship between figures 3 and 4 as the one observed between figure 1 and 2. Question Figure 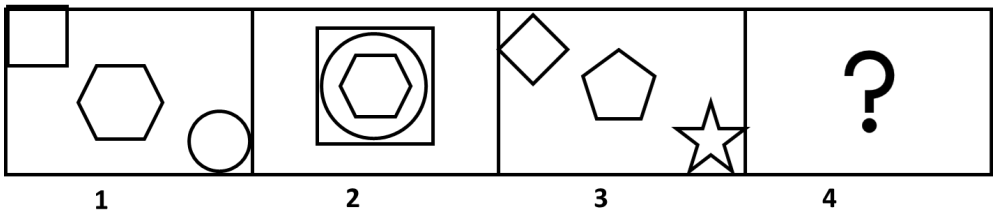 Answer Figures 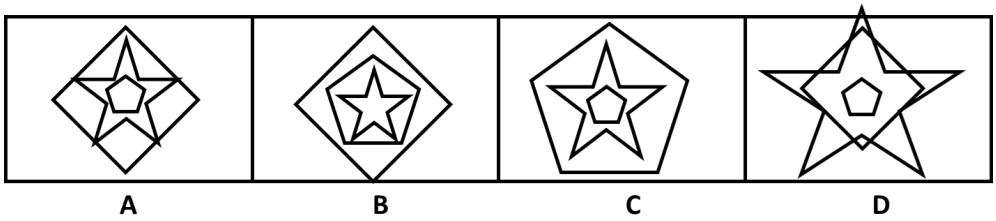
A	A
B	B
C	C
D	D
E	None of the above
Answer	A
Marks	1

Qno.	42
Question	Select a suitable figure from the four alternatives that would complete the figure matrix. 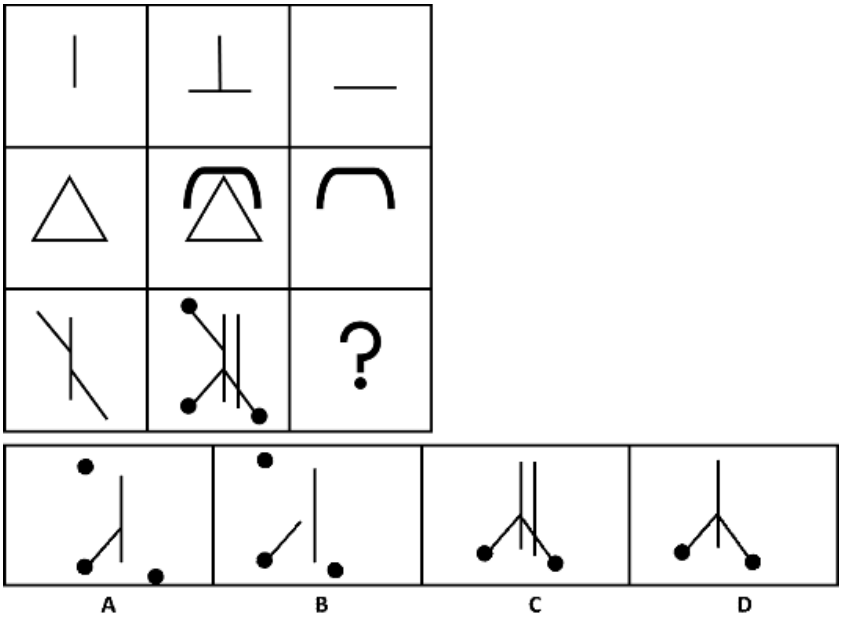
A	A
B	B
C	C
D	D
E	None of the above
Answer	B
Marks	1

Qno.	43
Question1.	Find how many quarter of a circle are present in the figure given below 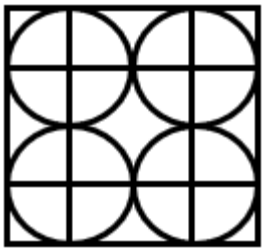
A	13
B	14
C	15
D	16
E	None of the above
Answer	D
Marks	1

Qno.	44
Question	Choose the figure which is different from the rest 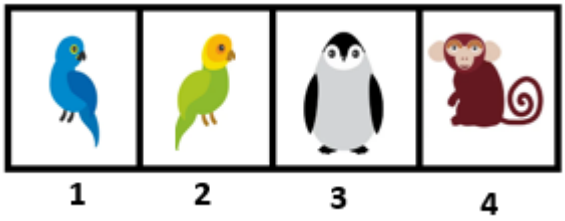
A	1
B	2
C	3
D	4
E	None of the above
Answer	D
Marks	1

Qno.	45
Question2.	Find the alternative figure which contains figure X as its part 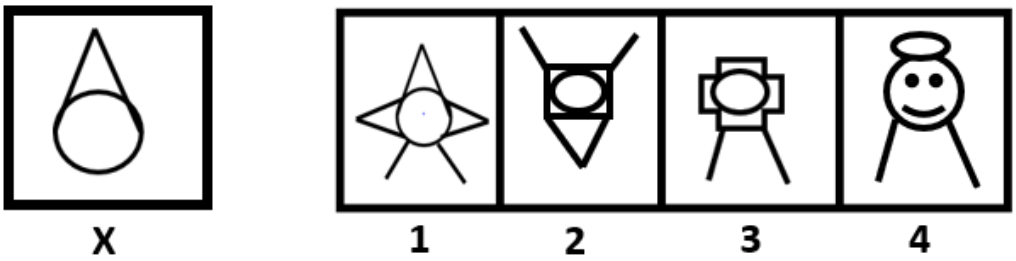
A	1
B	2
C	3
D	4
E	None of the above
Answer	A
Marks	1

Qno.	46
Question	Group the given figure into three classes using each figure only once 
A	1,6,8;2,4,9;3,5,7
B	1,4,7;2,5,8;3,6,9
C	1,2,3;4,5,6;7,8,9
D	1,3,8;2,4,7;5,6,9
E	None of the above
Answer	D
Marks	1

Qno.	47
Question	From the figures A, B, C and D, which figure would closely resemble the unfolded form of below figure? 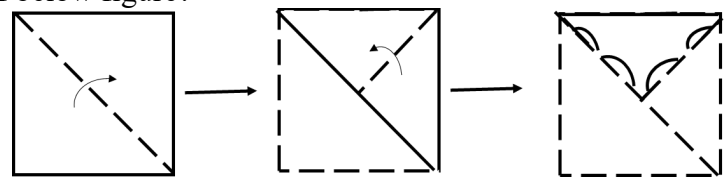 
A	A
B	B
C	C
D	D
E	None of the above
Answer	A
Marks	1

Qno.	48
Question	Select the alternative which represents three out of the five alternative figures which when fitted into each other would form a complete Square. 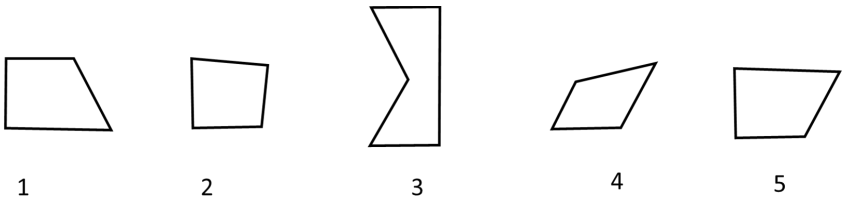
A	5, 2, 4
B	1, 3, 5
C	3, 4, 2
D	1, 2, 5
E	None of the above
Answer	B
Marks	1

Qno.	49
Question	Find the figure from the answer set **(1,2,3,4)** which will continue series given in the problem set **(A, B, C, D)** 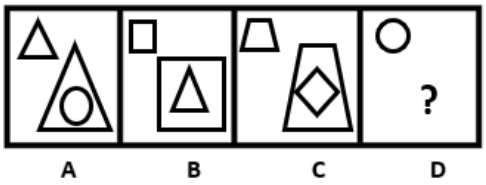 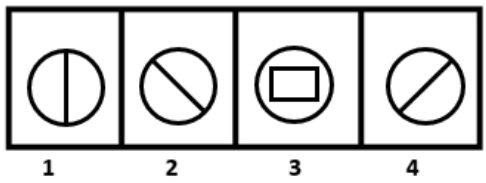
A	1
B	2
C	3
D	4
E	None of the above
Answer	C
Marks	1

Qno.	50
Question	Choose the correct option that closely resembles the water image of the following figure. 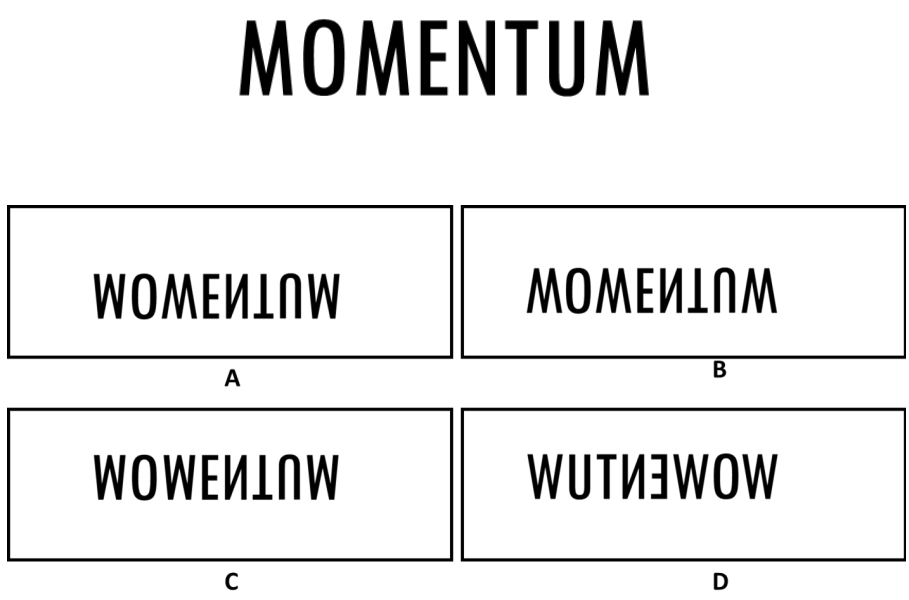
A	A
B	B
C	C
D	D
E	None of the above
Answer	C
Marks	1

Date	15/11/2026
Exam Time	08:45AM TO 10:00 AM

Qno.	41
Question	Select a suitable figure from the answer figures that will establish the similar relationship between figures 3 and 4 as the one observed between figure 1 and 2. Question Figure 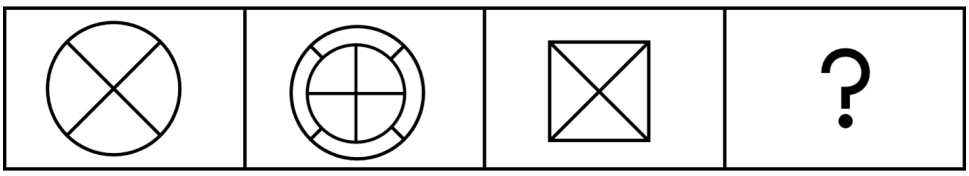 1 2 3 4 Answer Figures 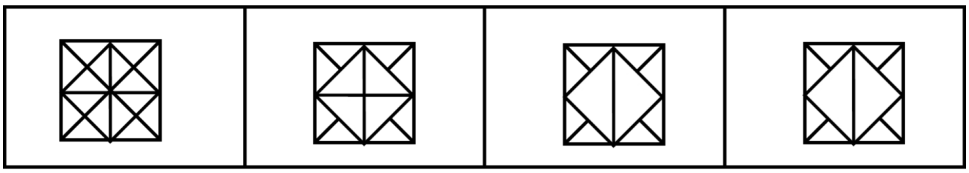 A B C D
A	A
B	B
C	C
D	D
E	None of the above
Answer	B
Marks	1

Qno.	42
Question	Identify the option that will complete the figure given below. 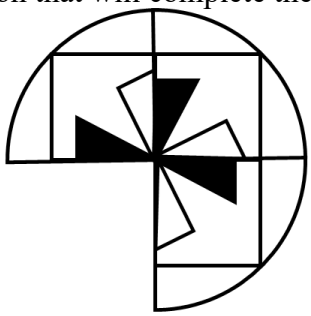 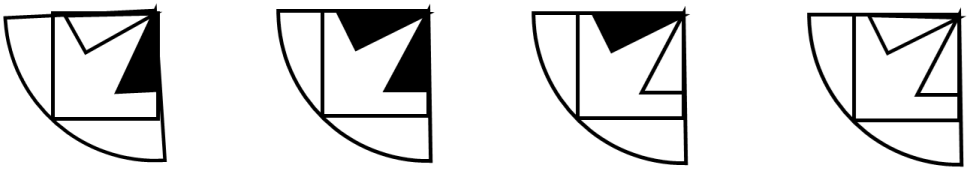 A B C D
A	A
B	B
C	C
D	D
E	None of the above
Answer	A
Marks	1

Qno.	43
Questionl.	The count of four sided figures from the image given below is ? 
A	10
B	12
C	13
D	14
E	None of the above
Answer	D
Marks	1

Qno.	44
Question2.	Choose the figure which is different from the rest 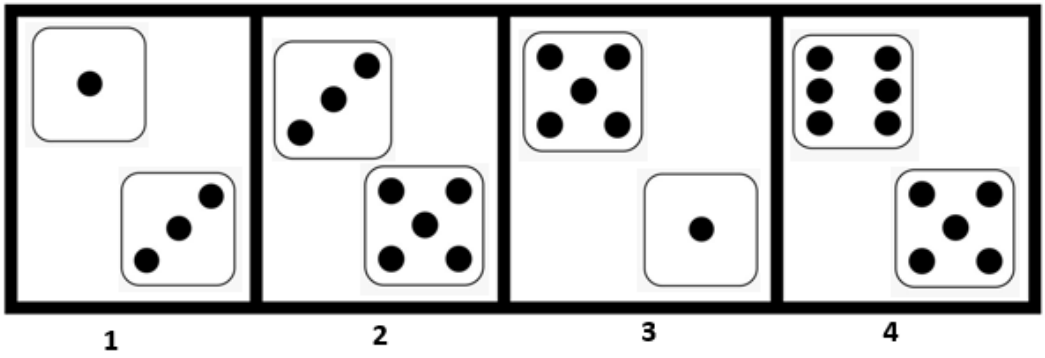
A	1
B	2
C	3
D	4
E	None of the above
Answer	D
Marks	1

Qno.	45
Question	Find the alternative figure which contains figure X as its part 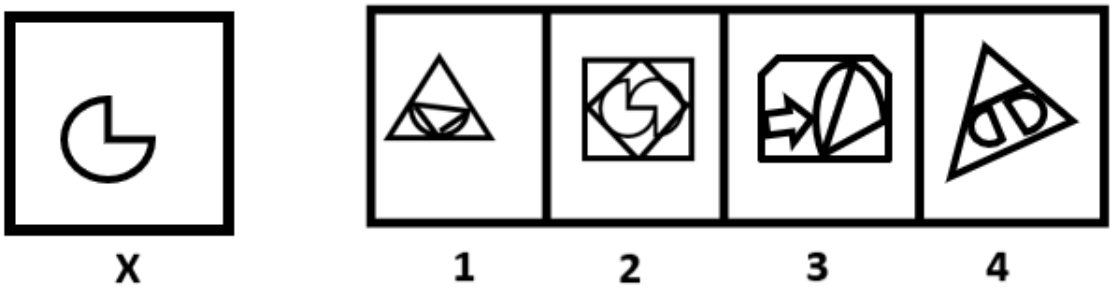
A	1
B	2
C	3
D	4
E	None of the above
Answer	B
Marks	1

Qno.	46
Question3.	Group the given figure into three classes using each figure only once 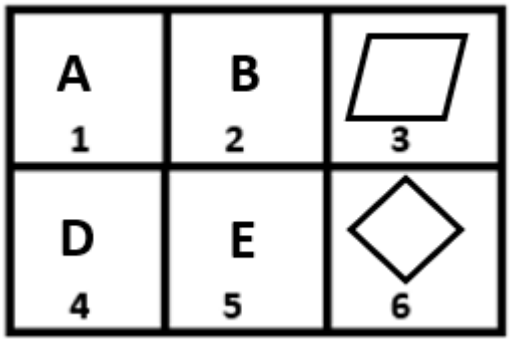
A	1,2;3,4;5,6
B	1,4;2,5;3,6
C	1,3;2,5;4,6
D	1,5;2,4;3,6
E	None of the above
Answer	D
Marks	1

Qno.	47
Question	Find out from amongst the four alternatives as to how the pattern would appear when the transparent sheet is folded at the dotted line in the direction of the arrow shown. 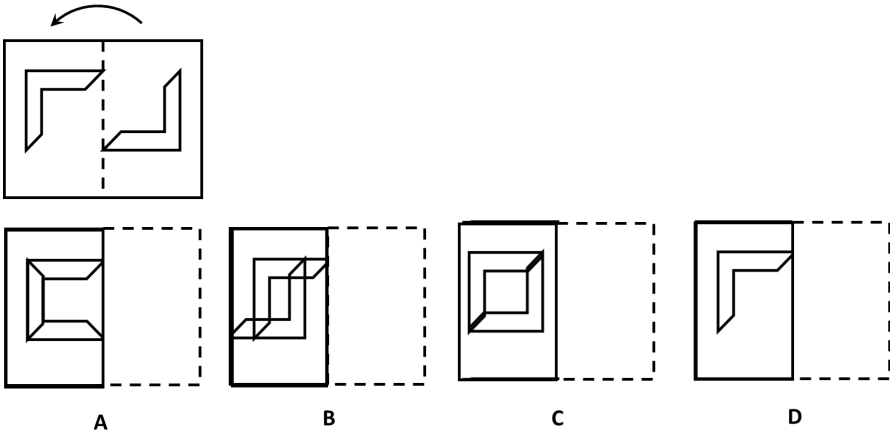
A	A
B	B
C	C
D	D
E	None of the above
Answer	A
Marks	1

Qno.	48
Question	Find out which of the figures (1), (2), (3) and (4) can be formed from the pieces given in figure (X). 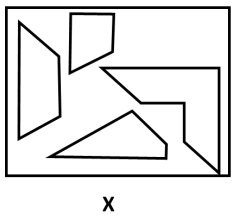 X 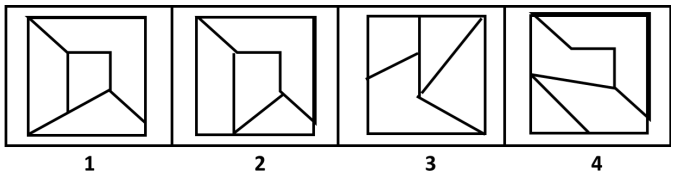 1 2 3 4
A	1
B	2
C	3
D	4
E	None of the above
Answer	A
Marks	1

Qno.	49
Question	Find the figure from the answer set **(1,2,3,4)** which will continue series given in the problem set **(A, B, C, D)** 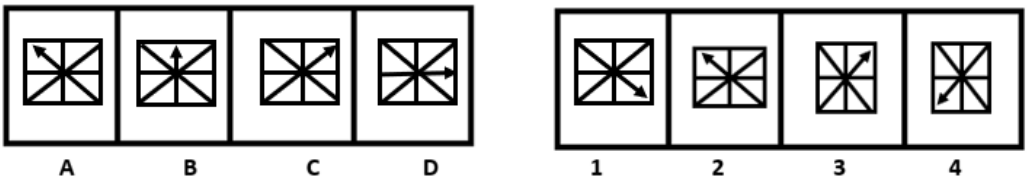
A	1
B	2
C	3
D	4
E	None of the above
Answer	A
Marks	1

Qno.	50
Question	Choose the correct option that closely resembles the mirror image of the following figure. 45896 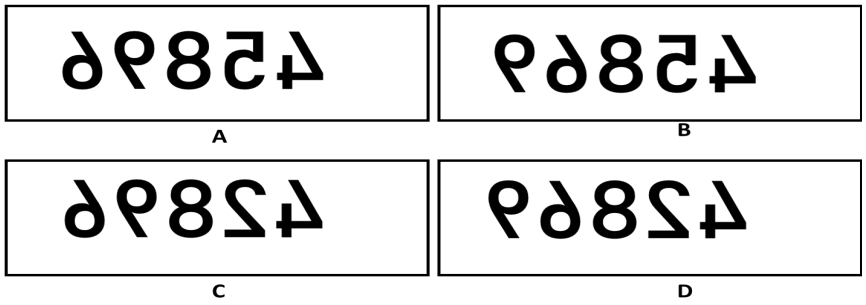
A	A
B	B
C	C
D	D
E	None of the above
Answer	A
Marks	1

Date	15/11/2026
Exam Time	10:45 AM TO 12:00 PM
Qno.	41
Question	Identify the figure that completes the pattern 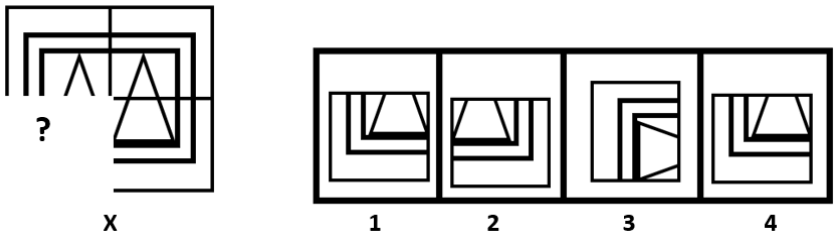
A	1
B	2
C	3
D	4
E	None of the above
Answer	A
Marks	1

Qno.	42
Question	Identify the option that will complete the figure given below. 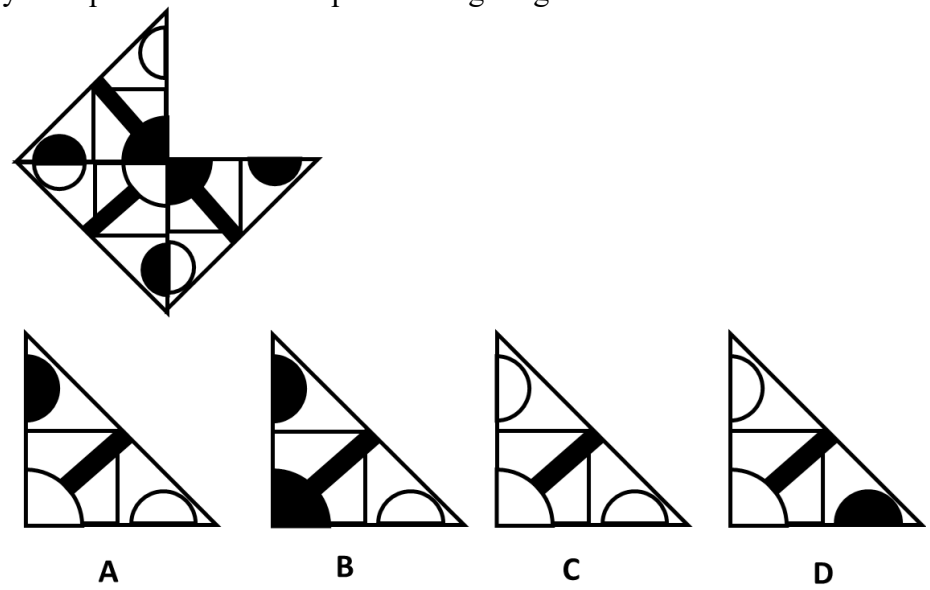
A	A
B	B
C	C
D	D
E	None of the above
Answer	A
Marks	1

Qno.	43
Questionl.	Find the number of quadrilaterals present in the figure given below? 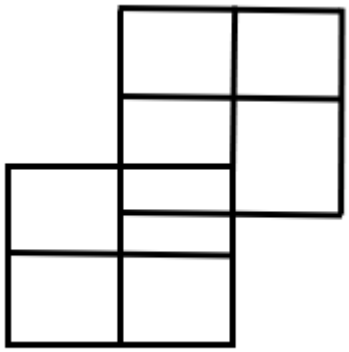
A	10
B	12
C	13
D	14
E	None of the above
Answer	E
Marks	1

Qno.	44
Question	Choose the figure that is different from rest. 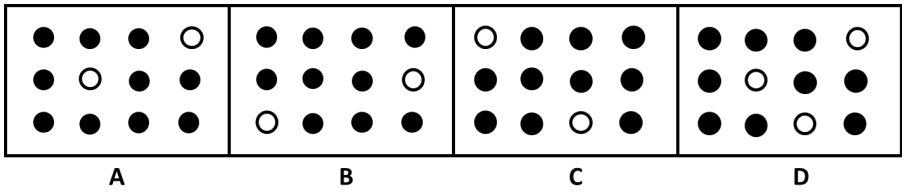
A	A
B	B
C	C
D	D
E	None of the above
Answer	D
Marks	1

Qno.	45
Question	Find the alternative figure which contain figure X as its part 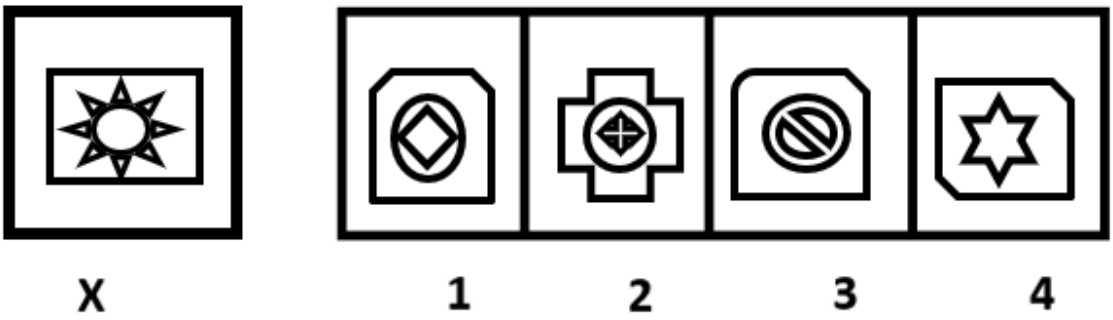
A	1
B	2
C	3
D	4
E	None of the above
Answer	E
Marks	1

Qno.	46
Question	Group the given figure into three classes using each figure only once. 
A	1,5,6; 3,4,8; 2,7,9
B	1,2,7; 3,5,9; 4,6,8
C	4,6,8; 3,5,7; 1,2,9
D	3,4,9; 5,7,8; 1,2,6
E	None of the above
Answer	B
Marks	1

Qno.	47
Question	Find out from amongst the four alternatives as to how the pattern would appear when the transparent sheet is folded at the dotted line in the direction of the arrow shown. 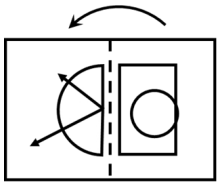 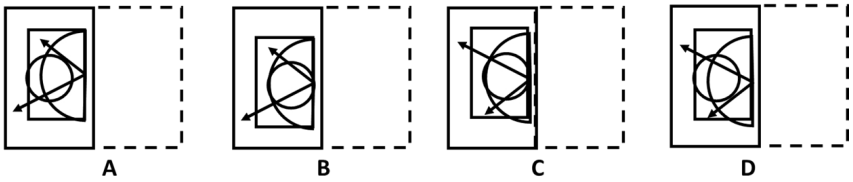
A	A
B	B
C	C
D	D
E	None of the above
Answer	A
Marks	1

Qno.	48
Question	Select the alternative which represents three out of the five alternative figures which when fitted into each other would form a complete Triangle.. 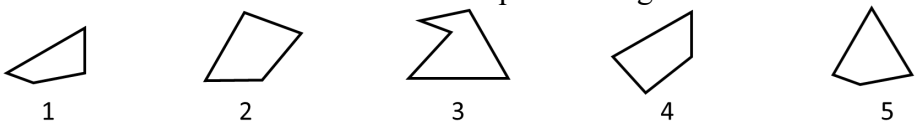 1 2 3 4 5
A	5, 2, 4
B	1, 3, 5
C	3, 2, 5
D	1, 2, 3
E	None of the above
Answer	C
Marks	1

Qno.	49
Question2.	Find the figure from the answer set **(1,2,3,4)** which will continue series given in the problem set **(A, B, C, D)** 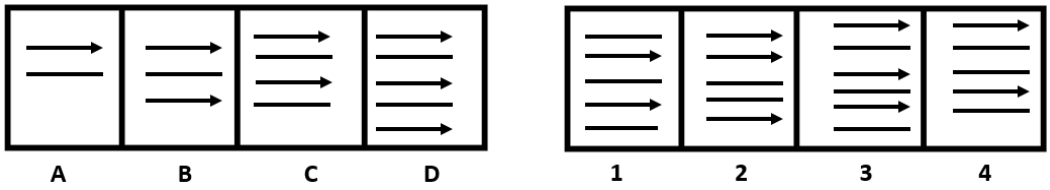
A	1
B	2
C	3
D	4
E	None of the above
Answer	C
Marks	1

Qno.	50
Question	Choose the option which resembles the water image of the following.  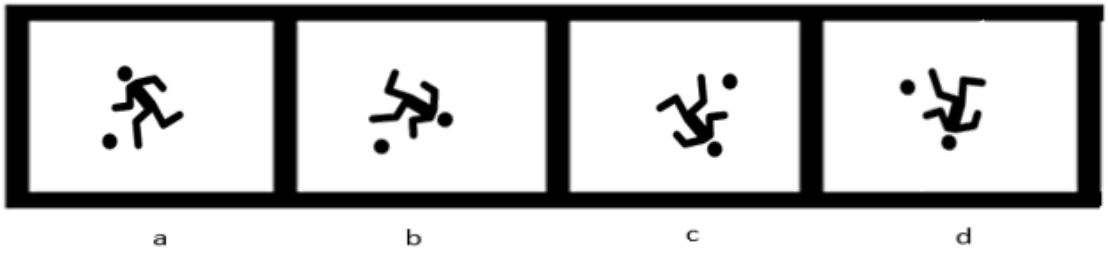
A	a
B	b
C	c
D	d
E	None of the above
Answer	C
Marks	1

Date	15/11/2026
Exam Time	12:45 PM TO 02:00 PM
Qno.	41
Question	Select a suitable figure from the answer figures that will establish the similar relationship between figures 3 and 4 as the one observed between figure 1 and 2. Question Figure 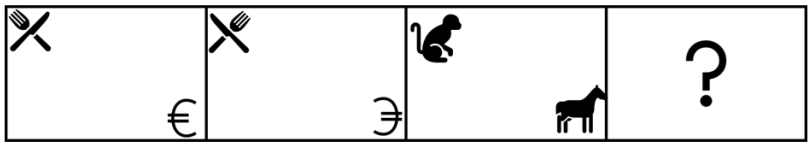 1 2 3 4 Answer Figures  A B C D
A	A
B	B
C	C
D	D
E	None of the above
Answer	C
Marks	1

Qno.	42
Question	Identify the option that will complete the figure given below. 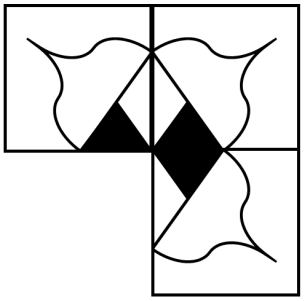 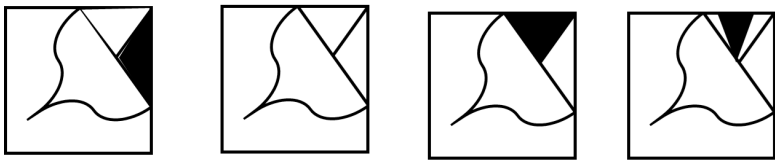 A B C D
A	A
B	B
C	C
D	D
E	None of the above
Answer	C
Marks	1

Qno.	43
Questionl.	Find the minimum number of straight lines required to make figure 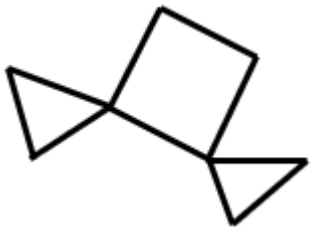
A	7
B	8
C	9
D	10
E	None of the above
Answer	D
Marks	1

Qno.	44
Question	Choose the figure that is different from the rest. 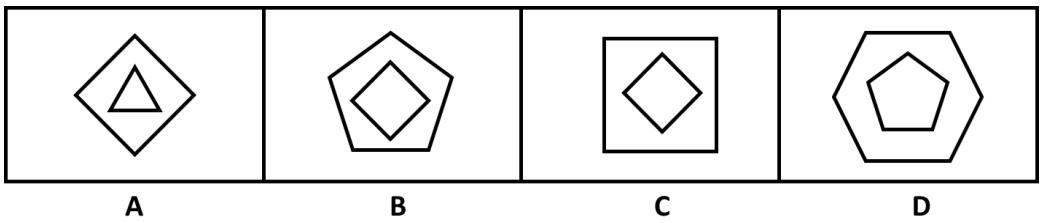
A	A
B	B
C	C
D	D
E	None of the above
Answer	C
Marks	1

Qno.	45
Question	Find out the alternative figure which contains figure (X) as its part. 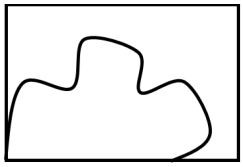 X  A B C D
A	A
B	B
C	C
D	D
E	None of the above
Answer	C
Marks	1

Qno.	46
Question2.	Group the given figure into three classes using each figure only once 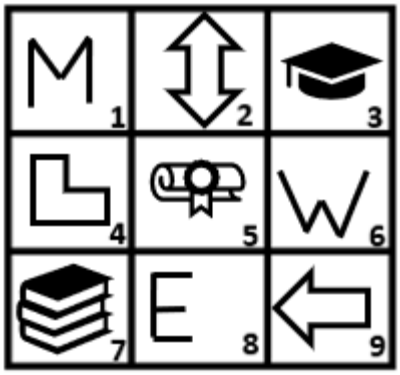
A	1,6,8;2,4,9;3,5,7
B	1,4,7;2,5,8;3,6,9
C	1,2,3;4,5,6;7,8,9
D	1,3,8;2,4,7;5,6,9
E	None of the above
Answer	A
Marks	1

Qno.	47
Question	Choose a figure which would most closely resemble the unfolded form of Figure (Y). 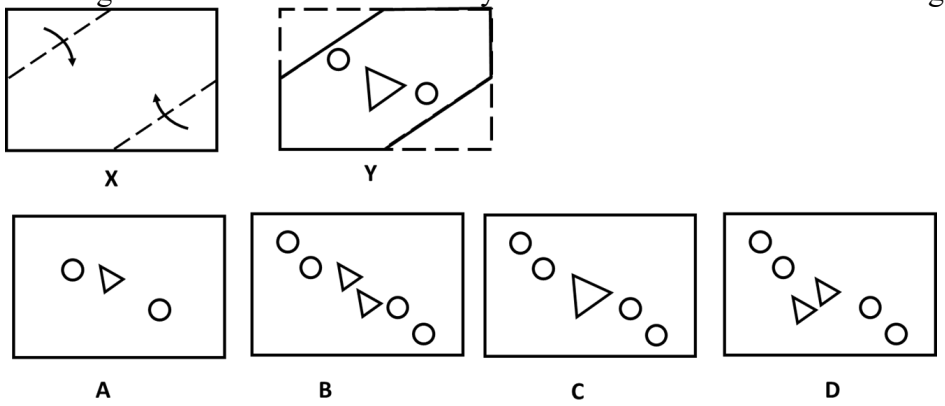
A	A
B	B
C	C
D	D
E	None of the above
Answer	C
Marks	1

Qno.	48
Question3.	Find out which of the following figures (1), (2), (3), (4) can be formed from the pieces given in the figure 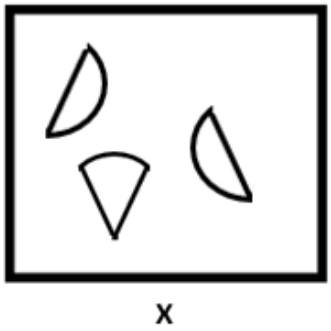 X 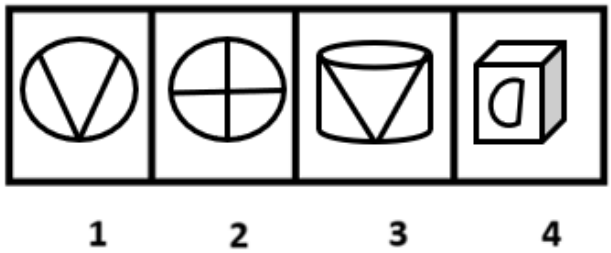 1 2 3 4
A	1
B	2
C	3
D	4
E	None of the above
Answer	A
Marks	1

Qno.	49
Question	The question below consists of two set of figures. Figures A,B,C,D constitutes problem set while figures 1,2,3,4 constitute answer set . There is definite relationship between figures A and B. Establish a suitable relationship between figures C and D by Selecting a suitable figure from the Answer Figures that would replace the question mark (?). 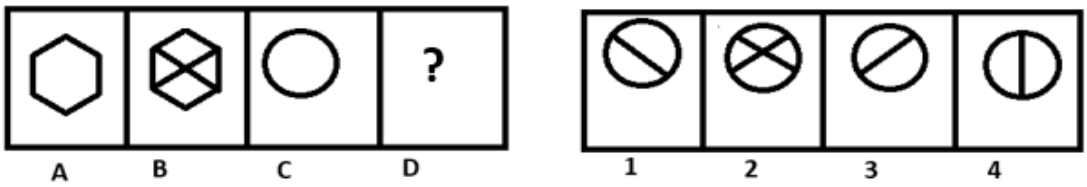
A	1
B	2
C	3
D	4
E	None of the above
Answer	B
Marks	1

Qno.	50
Question	Choose the correct option that closely resembles the mirror image of the following figure.  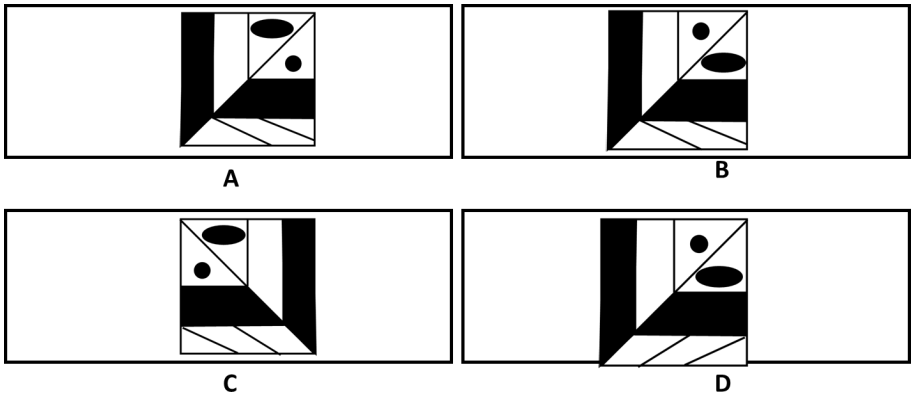
A	A
B	B
C	C
D	D
E	None of the above
Answer	B
Marks	1

Date	15/11/2026
Time	02:45 PM TO 04:00 PM
Qno.	41
Question	Select a suitable figure from the answer figures that will establish the similar relationship between figures 3 and 4 as the one observed between figure 1 and 2. Question Figure 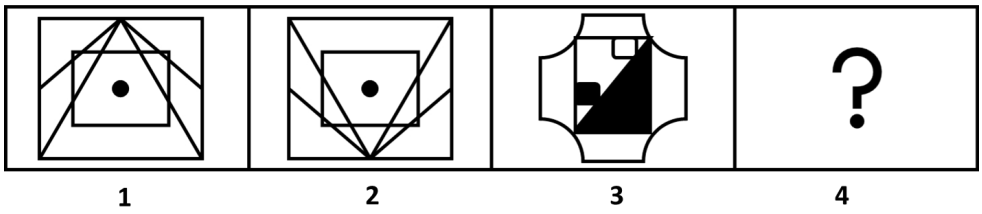 Answer Figures 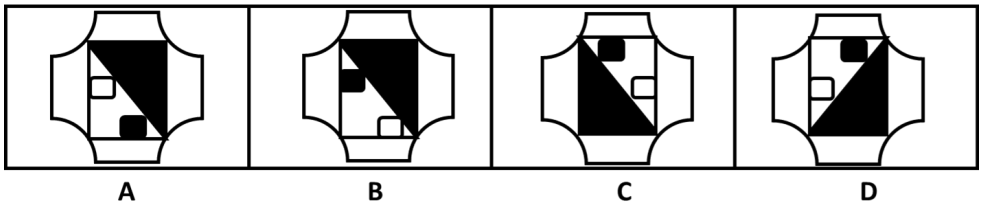
A	A
B	B
C	C
D	D
E	None of the above
Answer	B
Marks	1

Qno.	42
Question	Identify the option that will complete the figure given below.  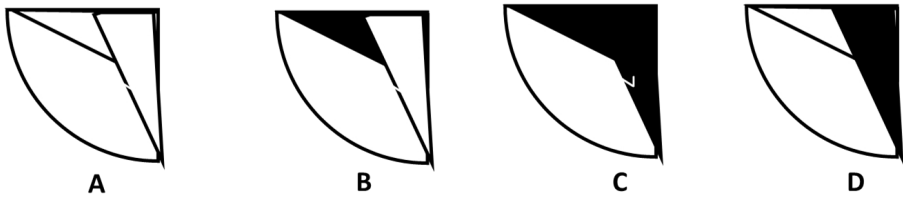
A	A
B	B
C	C
D	D
E	None of the above
Answer	D
Marks	1

Qno.	43
Questionl.	What type of rotation is seen in the figure given below? 
A	Clockwise
B	Counterclockwise
C	Rotation of 90 degrees
D	Rotation of 180 degrees
E	None of the above
Answer	A
Marks	1

Qno.	44
Question2.	Choose the figure which is different from the rest 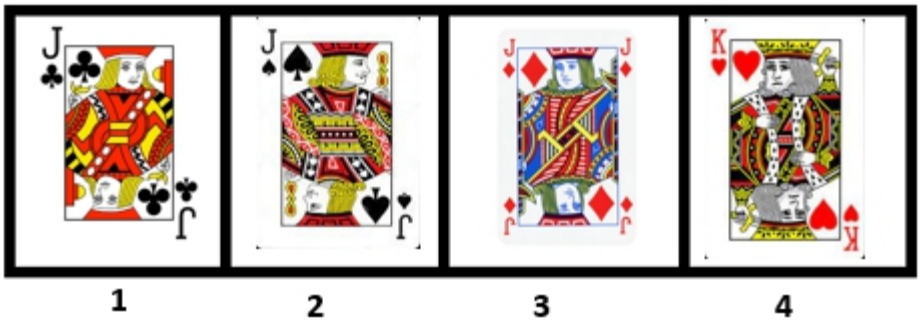
A	1
B	2
C	3
D	4
E	None of the above
Answer	D
Marks	1

Qno.	45
Question	Find out the alternative figure that contain figure X as its part. 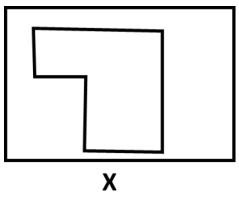 X 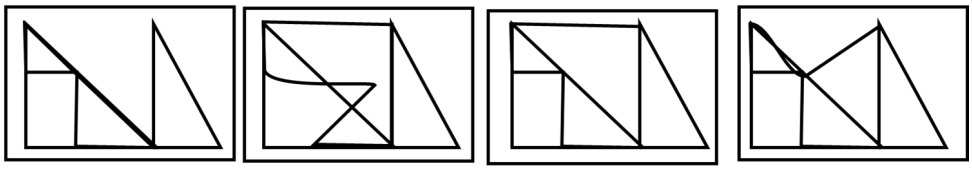 A B C D
A	A
B	B
C	C
D	D
E	None of the above
Answer	C
Marks	1

Qno.	46
Question3.	Group the given figure into three classes using each figure only once 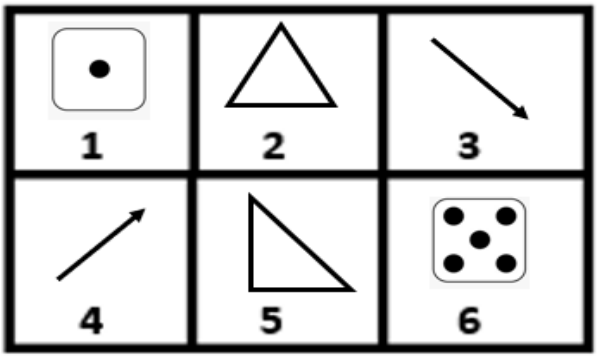
A	1,2;3,4;5,6
B	1,4;2,5;3,6
C	1,3;2,5;4,6
D	1,6;2,5;3,4
E	None of the above
Answer	D
Marks	1

Qno.	47
Question	Choose a figure which would most closely resemble the unfolded form of Figure (Z). 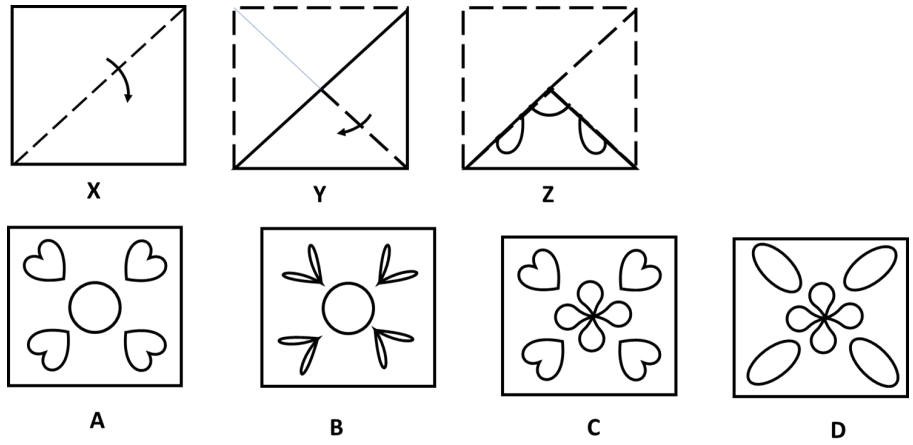
A	A
B	B
C	C
D	D
E	None of the above
Answer	A
Marks	1

Qno.	48
Question	Find out which of the figures (1), (2), (3) and (4) can be formed from the pieces given in figure (X).  X 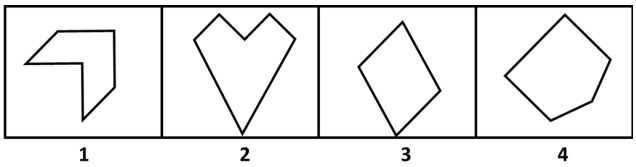 1 2 3 4
A	1
B	2
C	3
D	4
E	None of the above
Answer	B
Marks	1

Qno.	49
Question	Find the figure from the answer set **(1,2,3,4)** which will continue series given in the problem set **(A, B, C, D)** 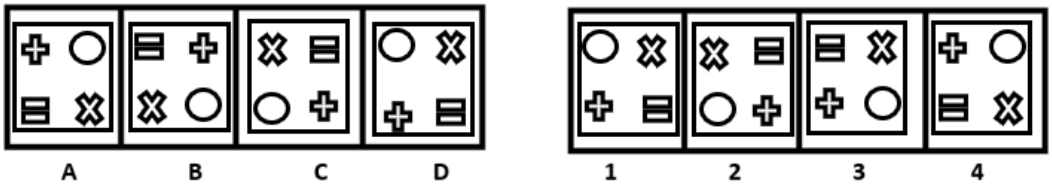
A	1
B	2
C	3
D	4
E	None of the above
Answer	D
Marks	1

Qno.	50
Question	Choose the alternative which closely resembles the mirror image of the given combination. TARAIN1014A
A	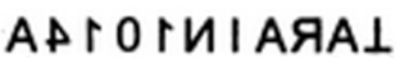
B	
C	
D	
E	None of the above
Answer	D
Marks	1

Date	15/11/2026
Exam Time	04:45 PM TO 06:00 PM

Qno.	41
Question	Select a suitable figure from the answer figures that will establish the similar relationship between figures 3 and 4 as the one observed between figure 1 and 2. Question Figure 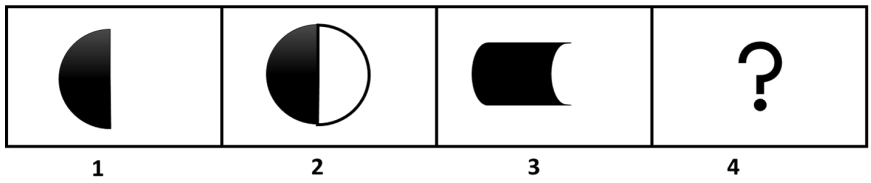 Answer Figures 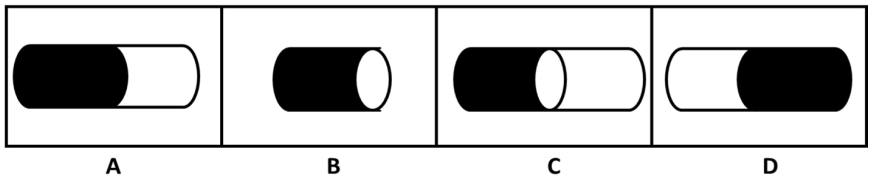
A	A
B	B
C	C
D	D
E	None of the above
Answer	C

Qno.	42
Question	Identify the option that will complete the figure given below.   A B C D
A	A
B	B
C	C
D	D
E	None of the above
Answer	B
Marks	1

Qno	43
Questionl.	Find number of triangles in the figure given below 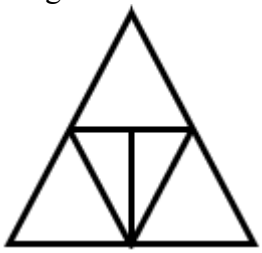
A	5
B	6
C	7
D	8
E	None of the above
Answer	C
Marks	1

Qno	44
Question2.	Choose the figure which is different from the rest 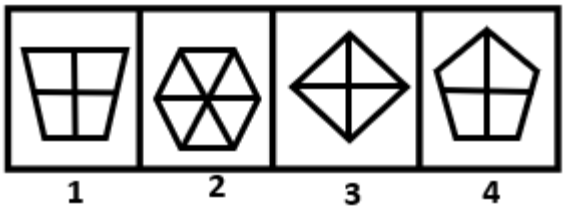
A	1
B	2
C	3
D	4
E	None of the above
Answer	B
Marks	1

Qno	45
Question3.	Find the alternative figure which contain figure X as its parts 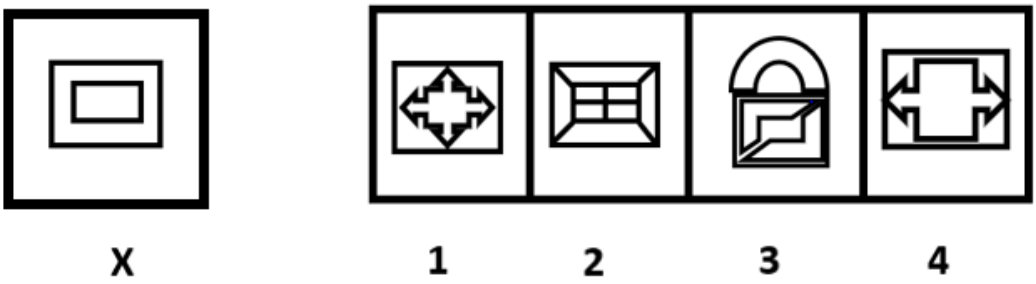
A	1
B	2
C	3
D	4
E	None of the above
Answer	B
Marks	1

Qno	46
Question	Group the given figure into three classes using each figure only once 
A	1,2,3;4,5,6;7,8,9
B	1,4,7;2,5,6;3,8,9
C	1,2,3;4,5,6;7,8,9
D	1,3,8;2,4,7;5,6,9
E	None of the above
Answer	B
Marks	1

Qno	47
Question	Choose a figure which would most closely resemble the unfolded form of Figure (Z). 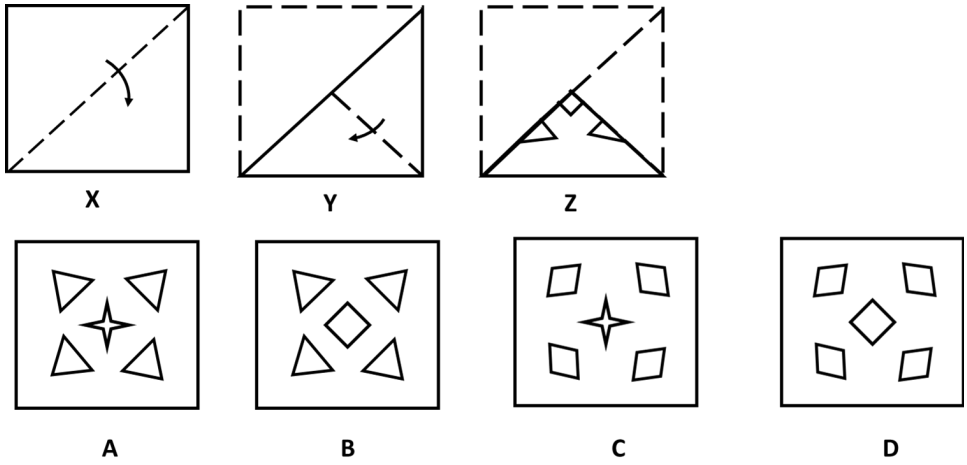
A	A
B	B
C	C
D	D
E	None of the above
Answer	B
Marks	1

Qno	48
Question	Find out which of the figures (1), (2), (3) and (4) can be formed from the pieces given in figure (X). 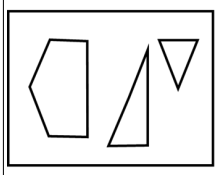 X 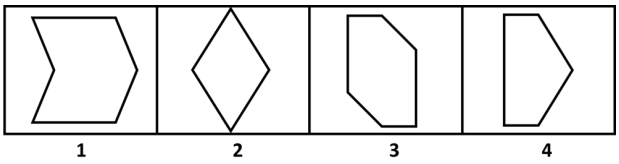 1 2 3 4
A	1
B	2
C	3
D	4
E	None of the above
Answer	A
Marks	1

Qno	49
Question.	The question below consists of two set of figures. Figures A,B,C,D constitutes problem set while figures 1,2,3,4 constitute answer set . There is definite relationship between figures A and B. Establish a suitable relationship between figures C and D by Selecting a suitable figure from the Answer Figures that would replace the question mark (?). 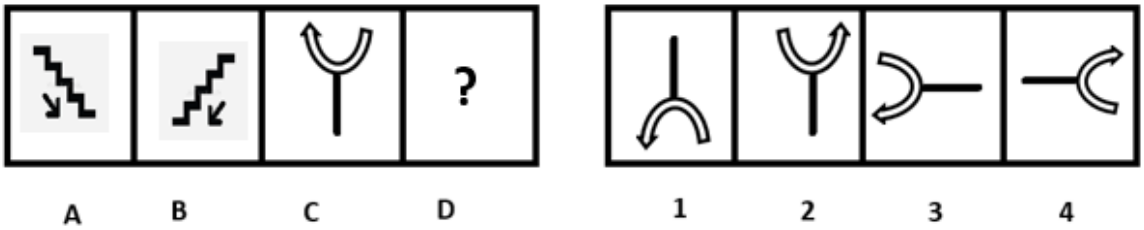
A	1
B	2
C	3
D	4
E	None of the above
Answer	B
Marks	1

Qno	50
Question	Choose the correct option that closely resembles the water image of the following figure 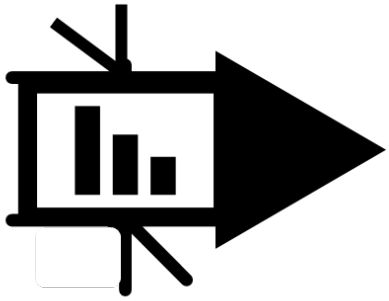 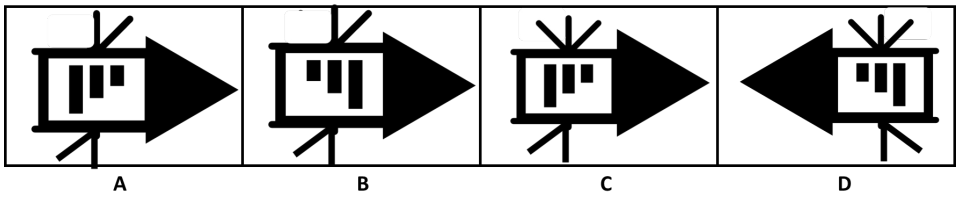
A	A
B	B
C	C
D	D
E	None of the above
Answer	A
Marks	1

Date	21/11/2026
Exam Time	09:15 AM TO 10:30 AM
Qno.	41
Questionl.	Identify the figure that completes the pattern 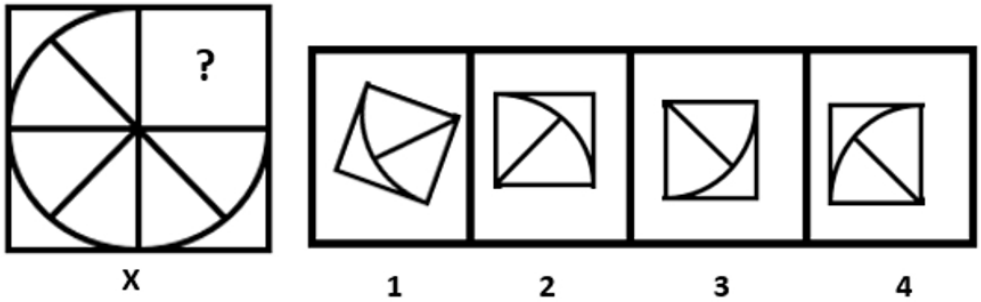
A	1
B	2
C	3
D	4
E	None of the above
Answer	B
Marks	1

Qno.	42
Question	Select a suitable figure from the four alternatives that would complete the figure matrix. 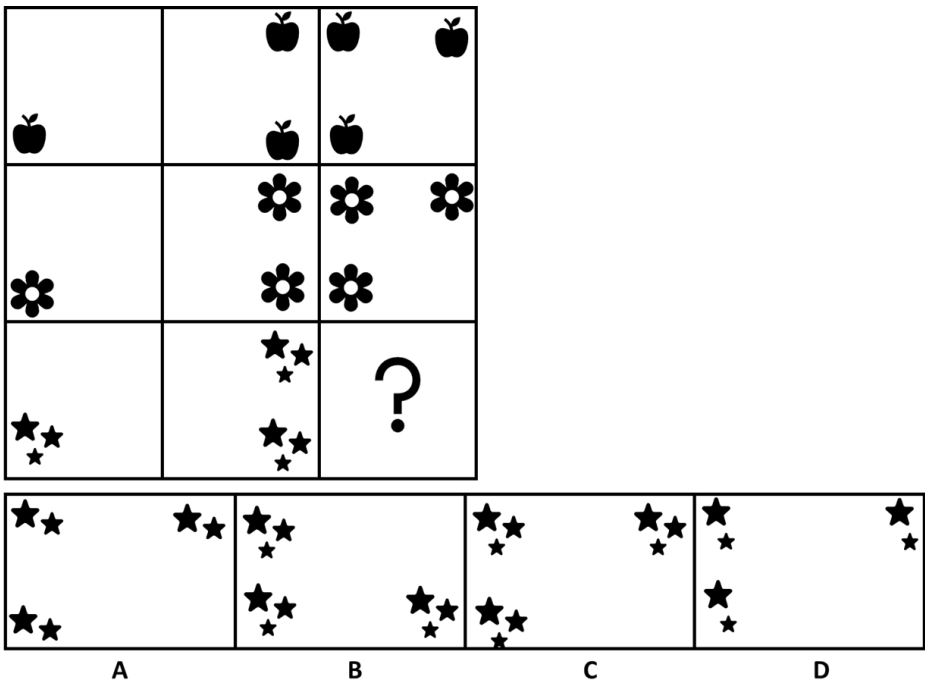
A	A
B	B
C	C
D	D
E	None of the above
Answer	C
Marks	1

Qno.	43
Question2.	Find number of trapezium present in the figure given below 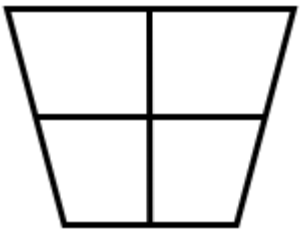
A	2
B	3
C	4
D	5
E	None of the above
Answer	C
Marks	1

Qno.	44
Question3.	Choose the figure which is different from the rest 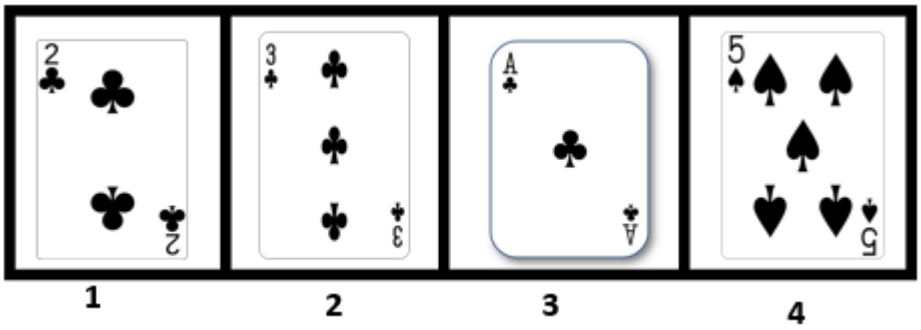
A	1
B	2
C	3
D	4
E	None of the above
Answer	D
Marks	1

Qno.	45
Question	Find the alternative figure which contain figure X as its parts 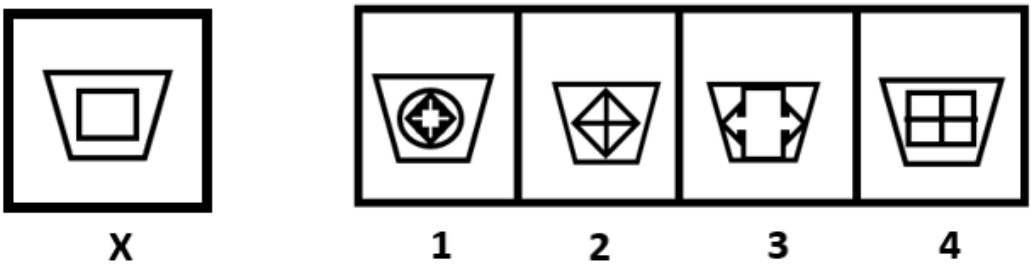
A	1
B	2
C	3
D	4
E	None of the above
Answer	D
Marks	1

Qno.	46
Question5.	Group the given figure into three classes using each figure only once 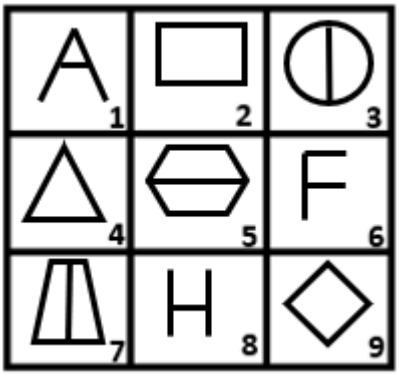
A	1,5,9;2,3,6;4,7,8
B	1,4,7;2,5,8;3,6,9
C	1,2,3;4,5,6;7,8,9
D	1,6,8;2,4,9;3,5,7
E	None of the above
Answer	D
Marks	1

Qno.	47
Question	Choose a figure which would most closely resemble the unfolded form of Figure (Y). 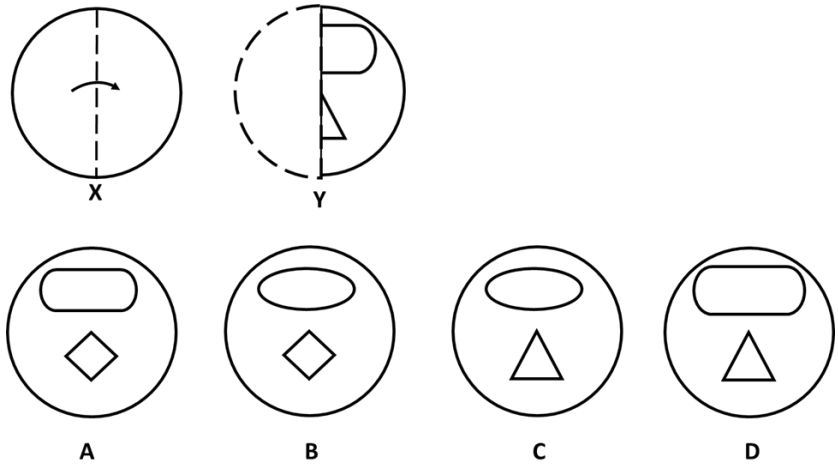
A	A
B	B
C	C
D	D
E	None of the above
Answer	D
Marks	1

Qno.	48
Question	6. Find out which of the following figures (1) , (2), (3), (4) can be formed from the pieces given in the figure 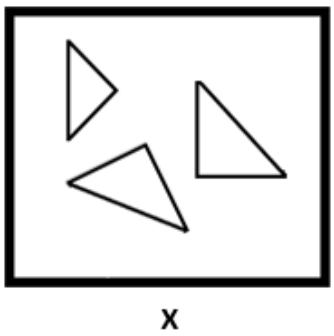 X 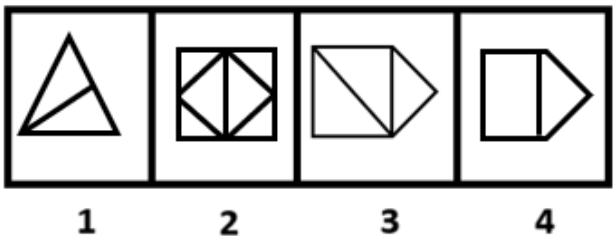 1 2 3 4
A	1
B	2
C	3
D	4
E	None of the above
Answer	C
Marks	1

Qno.	49
Question7.	Find the figure from the answer set **(1,2,3,4)** which will continue series given in the problem set **(A, B, C, D)** 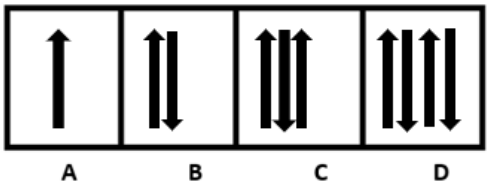 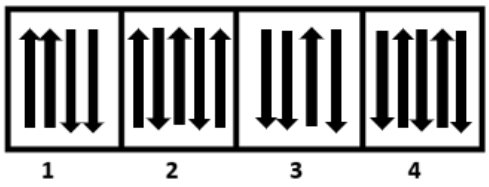
A	1
B	2
C	3
D	4
E	None of the above
Answer	B
Marks	1

Qno.	50
Question	Choose the correct option that closely resembles the water image of the following figure. 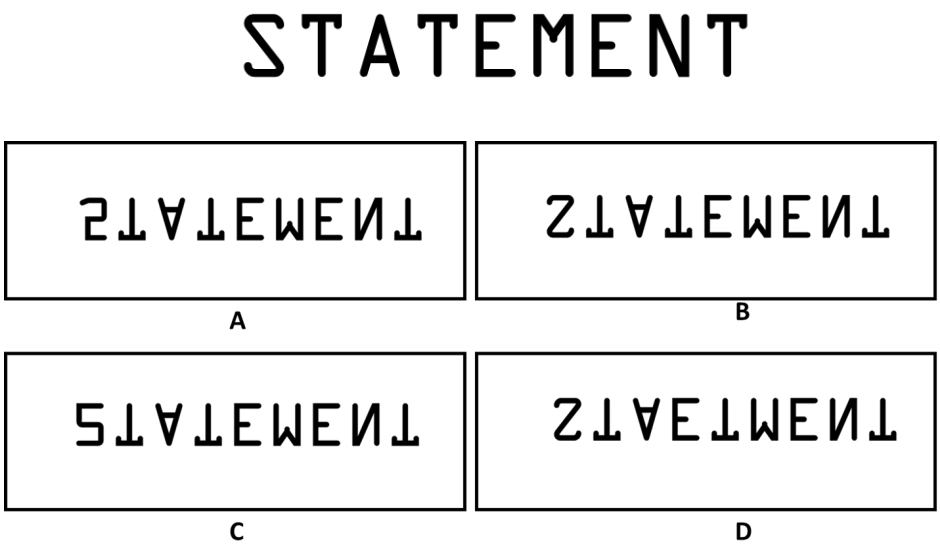
A	A
B	B
C	C
D	D
E	None of the above
Answer	B
Marks	1

Date	21/11/2026
Exam Time	11:30 AM TO 12:45 PM
Qno.	41
Question	Select a suitable figure from the answer figures that will establish the similar relationship between figures 3 and 4 as the one observed between figure 1 and 2. Question Figure 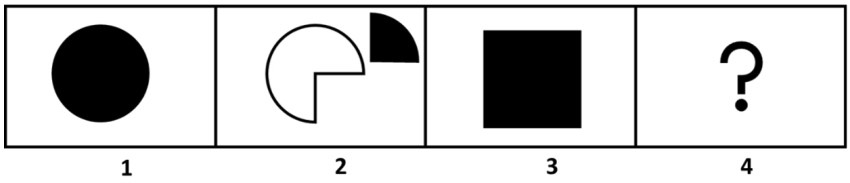 Answer Figures 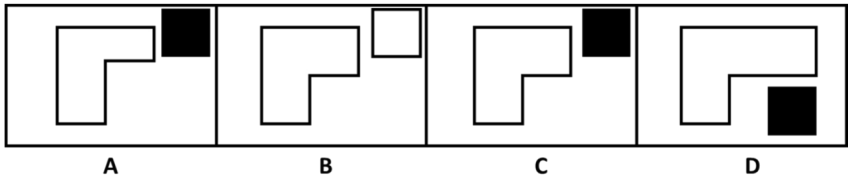
A	A
B	B
C	C
D	D
E	None of the above
Answer	C
Marks	1

Qno.	42
Question	Identify the option that will complete the figure given below. 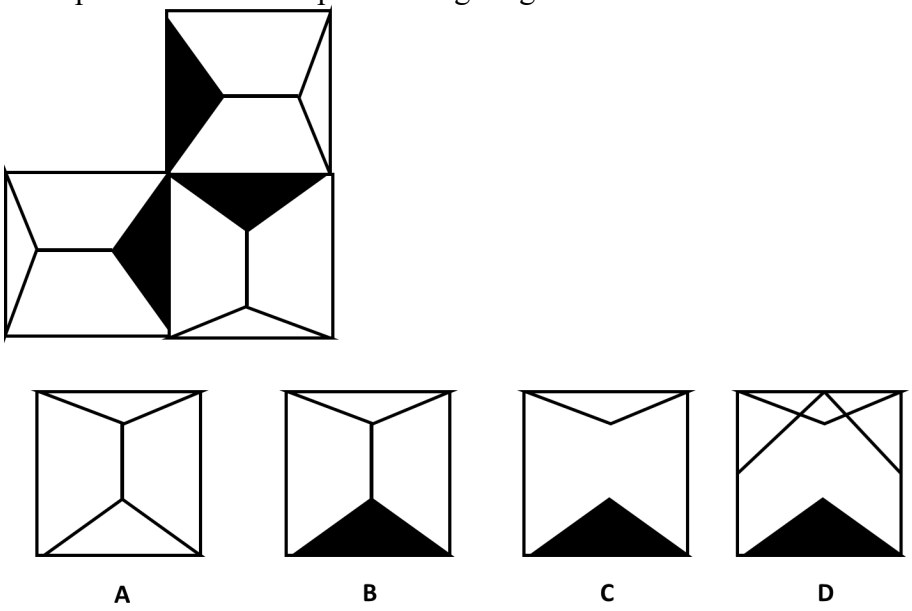
A	A
B	B
C	C
D	D
E	None of the above
Answer	B
Marks	1

Qno.	43
Question	Find the number of triangles in the following figure 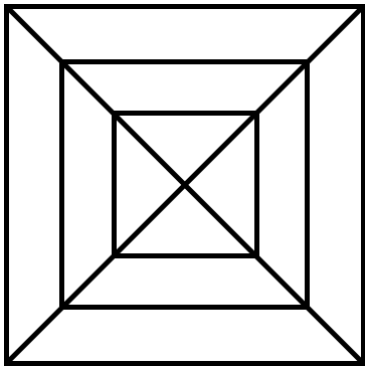
A	9
B	10
C	18
D	24
E	None of the above
Answer	D
Marks	1

Qno.	44
Question1.	Choose the figure which is different from the rest 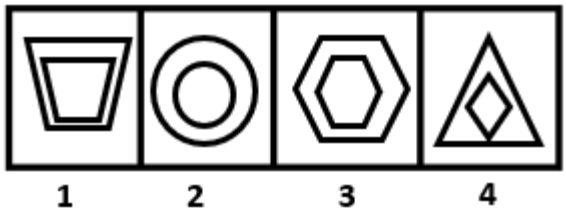
A	1
B	2
C	3
D	4
E	None of the above
Answer	D
Marks	1

Qno.	45
Question	Find the alternative figure which contain figure X as its part 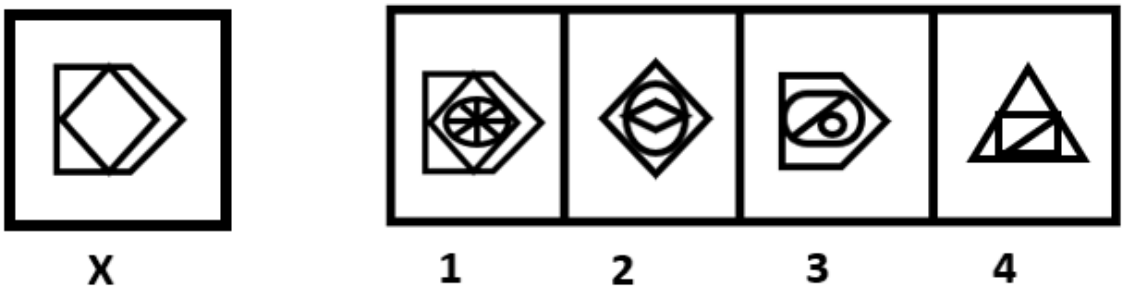
A	1
B	2
C	3
D	4
E	None of the above
Answer	A
Marks	1

Qno.	46
Question2.	Group the given figure into three classes using each figure only once 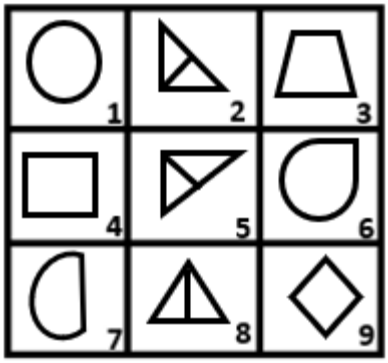
A	1,2,3;4,5,6;7,8,9
B	1,4,7;2,5,8;3,6,9
C	1,5,9;2,3,6;4,7,8
D	1,6,7;2,5,8;3,4,9
E	None of the above
Answer	D
Marks	1

Qno.	47
Question	Choose a figure which would most closely resemble the unfolded form of Figure (Z). 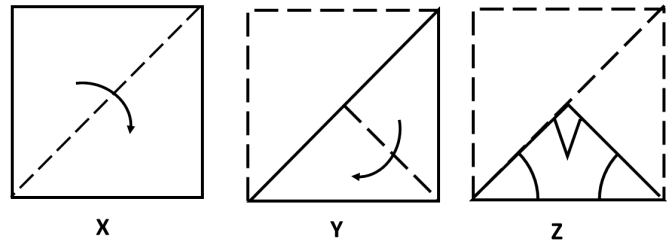 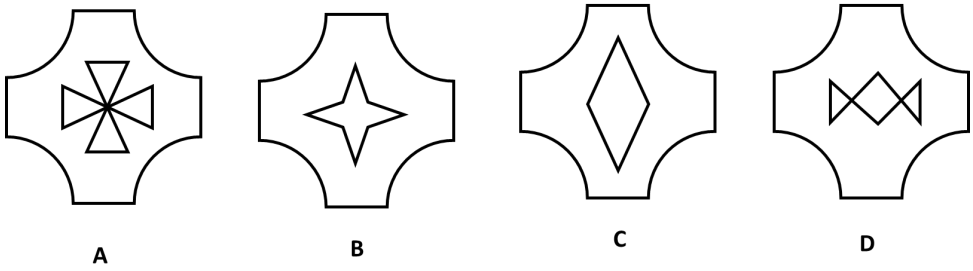
A	A
B	B
C	C
D	D
E	None of the above
Answer	B
Marks	1

Qno.	48
Question	Find out which of the figures (1), (2), (3) and (4) can be formed from the pieces given in figure (X). 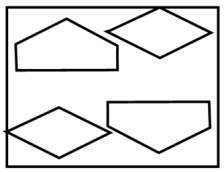 X 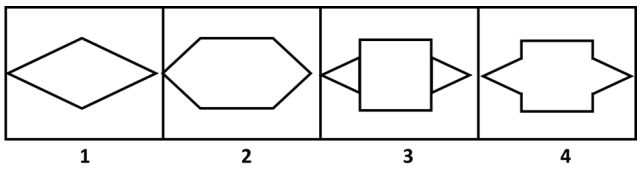 1 2 3 4
A	1
B	2
C	3
D	4
E	None of the above
Answer	D
Marks	1

Qno.	49
Question	Select the suitable figure from the answer figures that would replace the question mark (?) Problem Figures: 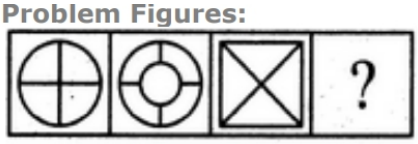 Answer Figures: 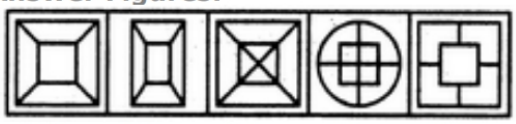
A	1
B	2
C	3
D	4
E	None of the above
Answer	A
Marks	1

Qno.	50
Question	Choose the alternative which is closely resembles the water images of the given combination gr2p8sghhi 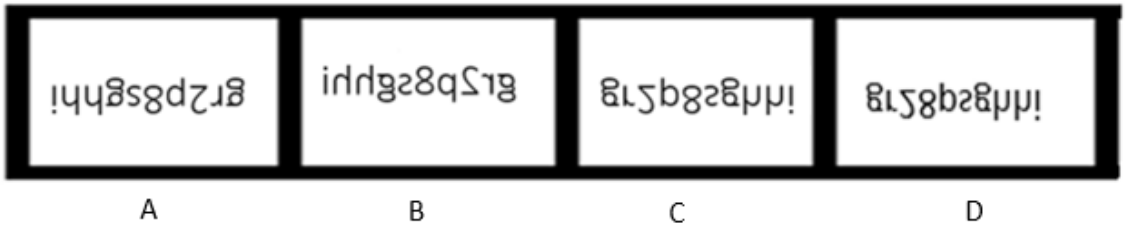 A B C D
A	A
B	B
C	C
D	D
E	None of the above
Answer	C
Marks	1

Date	21/11/2026
Exam Time	02:00 PM TO 03:15 PM

Qno.	41
Questionl.	Identify the figure that completes the pattern 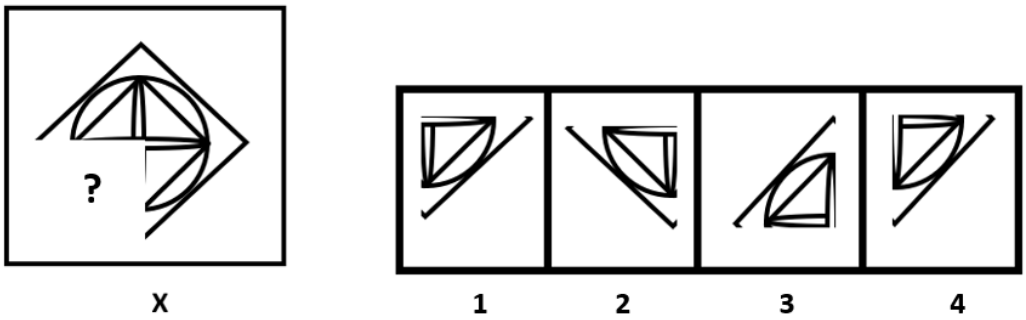
A	1
B	2
C	3
D	4
E	None of the above
Answer	B
Marks	1

Qno.	42
Question	Identify the option that will complete the figure given below. 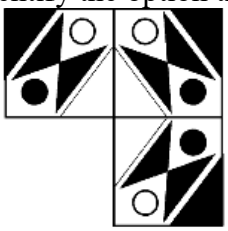 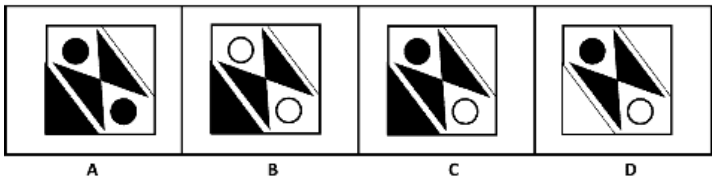
A	A
B	B
C	C
D	D
E	None of the above
Answer	C
Marks	1

Qno.	43
Question2.	Choose the letter which is different from the rest 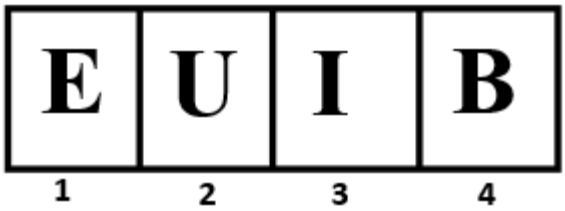
A	1
B	2
C	3
D	4
E	None of the above
Answer	D
Marks	1

Qno.	44
Question3.	Choose the figure which is different from the rest 
A	1
B	2
C	3
D	4
E	None of the above
Answer	C
Marks	1

Qno.	45
Question	Find out the alternative figure which contains figure (X) as its part. 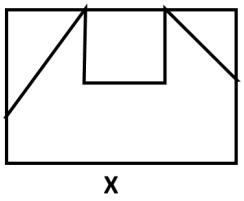 X 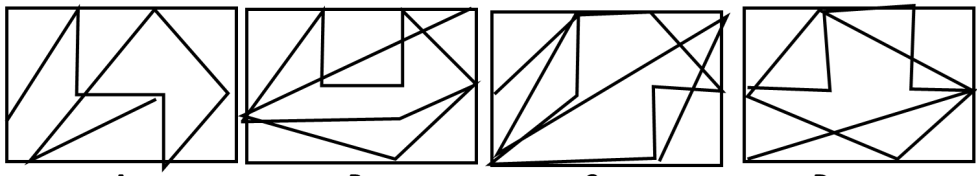 A B C D
A	A
B	B
C	C
D	D
E	None of the above
Answer	B
Marks	1

Qno.	46
Question	4. Group the given figure into three classes using each figure only once 
A	1,2,3;4,5,6;7,8,9
B	1,5,9;2,4,7;3,6,8
C	1,3,8;2,4,6;5,7,9
D	1,4,7;2,5,8;3,6,9
E	None of the above
Answer	C
Marks	1

Qno.	47
Question	Find out from amongst the four alternatives as to how the pattern would appear when the transparent sheet is folded at the dotted line in the direction of the arrow shown. 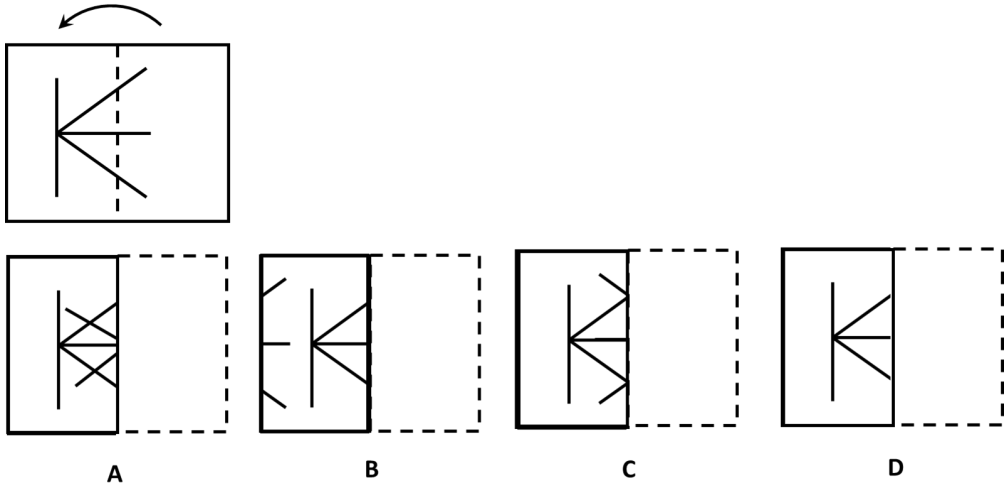
A	A
B	B
C	C
D	D
E	None of the above
Answer	C
Marks	1

Qno.	48
Question	Find out which of the following figures (1), (2), (3), (4) can be formed from the pieces given in the figure 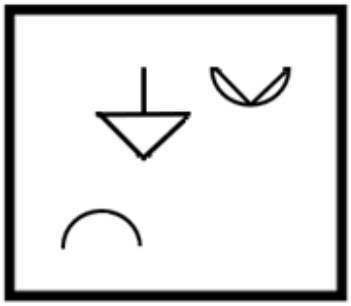 X 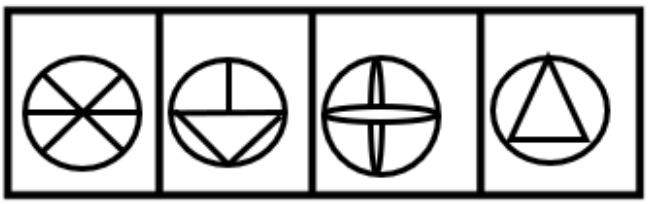 1 2 3 4
A	1
B	2
C	3
D	4
E	None of the above
Answer	B
Marks	1

Qno.	49
Question	The question below consists of two set of figures. Figures A,B,C,D constitutes problem set while figures 1,2,3,4 constitute answer set . There is definite relationship between figures A and B. Establish a suitable relationship between figures C and D by Selecting a suitable figure from the Answer Figures that would replace the question mark (?). 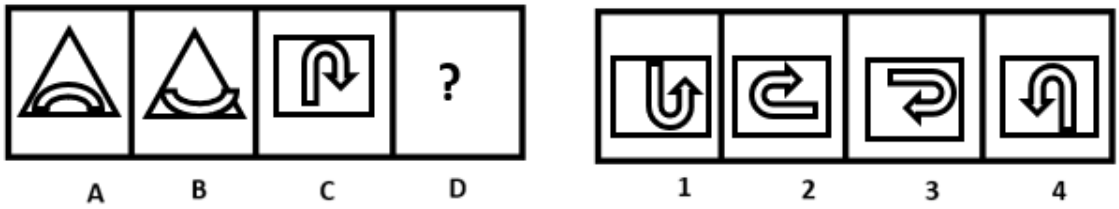
A	1
B	2
C	3
D	4
E	None of the above
Answer	A
Marks	1

Qno.	50
Question	Choose the correct option that closely resembles the mirror image of the following figure. 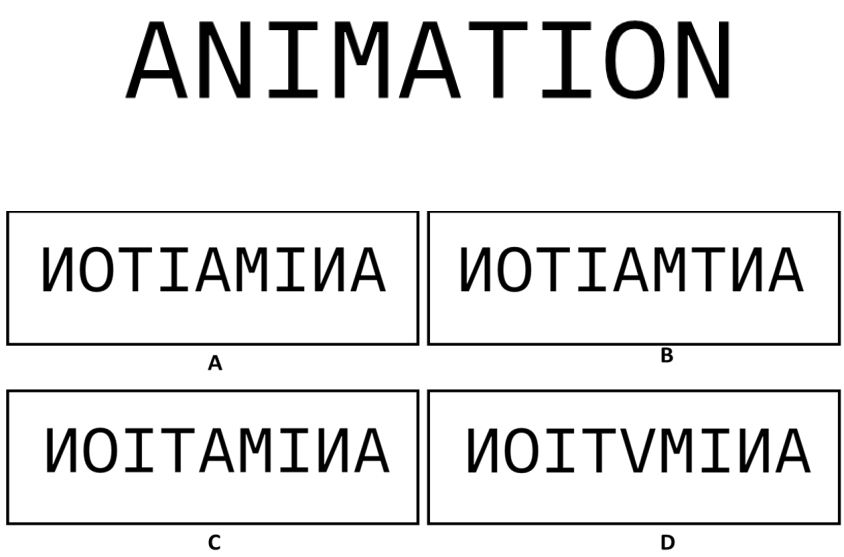
A	A
B	B
C	C
D	D
E	None of the above
Answer	C
Marks	1

Date	21/11/2026
Exam Time	04:15 PM TO 05:30 PM
Qno.	41
Question	Identify the figure that completes the pattern 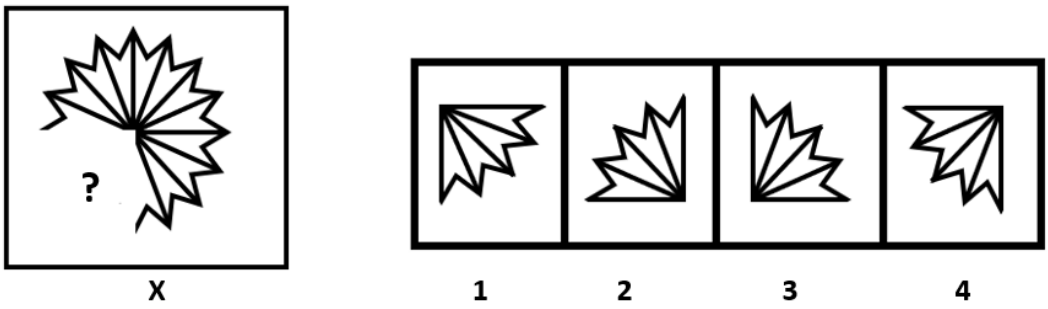
A	1
B	2
C	3
D	4
E	None of the above
Answer	D
Marks	1

Qno.	42
Question	Select a suitable figure from the four alternatives that would complete the figure matrix 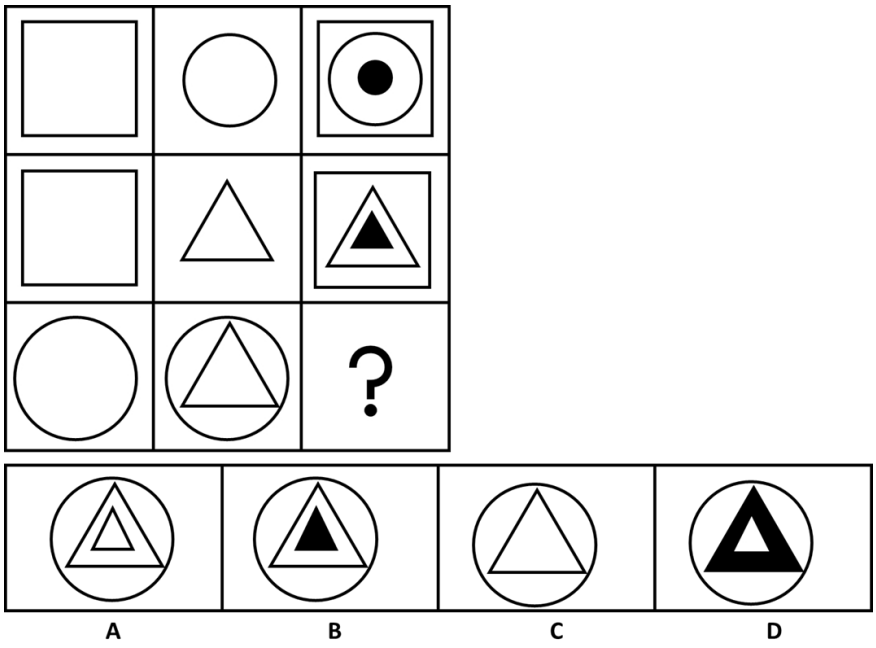
A	A
B	B
C	C
D	D
E	None of the above
Answer	B
Marks	1

Qno.	43
Questionl.	Find number of squares present in the figure given below 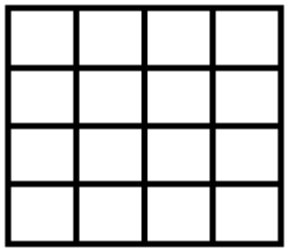
A	16
B	20
C	22
D	23
E	None of the above
Answer	D
Marks	1

Qno.	44
Question2.	Choose the figure which is different from the rest 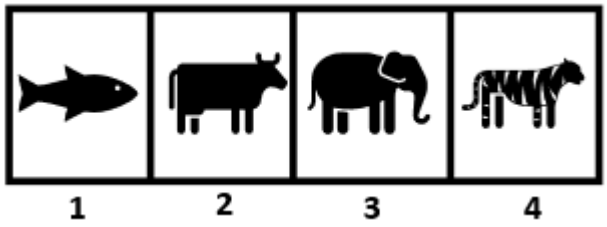
A	1
B	2
C	3
D	4
E	None of the above
Answer	A
Marks	1

Qno.	45
Question	Find the alternative figure which contain figure X as its part 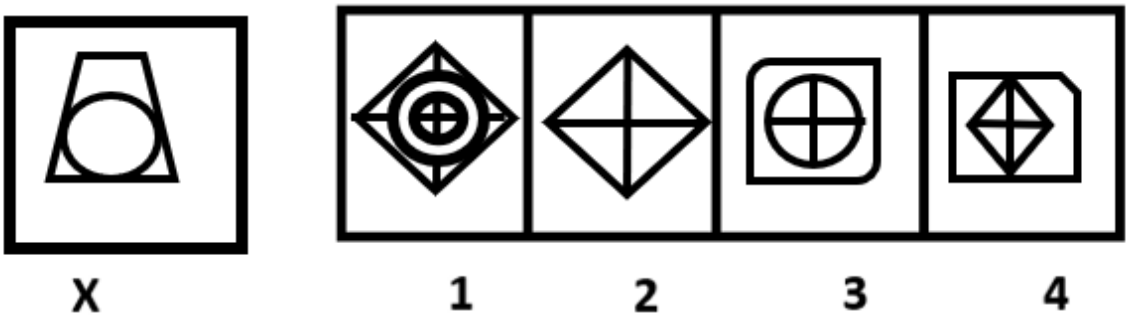
A	1
B	2
C	3
D	4
E	None of the above
Answer	E
Marks	1

Qno.	46
Question	Group the given figures into three classes using each figure only once. 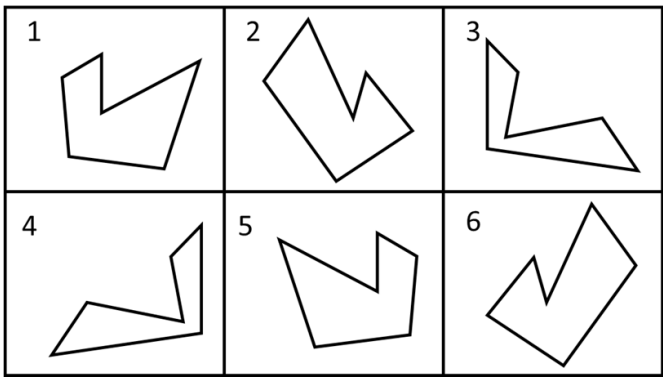
A	(1,4), (2,5), (3,6)
B	(1,5), (2,6), (3,4)
C	(1,2), (3,4), (5,6)
D	(1,3), (2,4), (5,6)
E	None of the above
Answer	B
Marks	1

Qno.	47
Question	Find out from amongst the four alternatives as to how the pattern would appear when the transparent sheet is folded at the dotted line in the direction of the arrow shown. 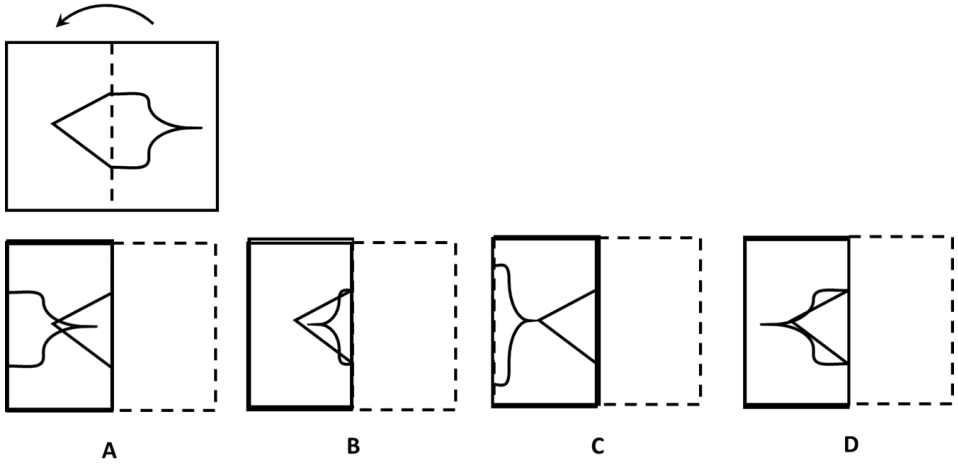
A	A
B	B
C	C
D	D
E	None of the above
Answer	D
Marks	1

Qno.	48
Question3.	Find out which of the following figures (1), (2), (3), (4) can be formed from the pieces given in the figure 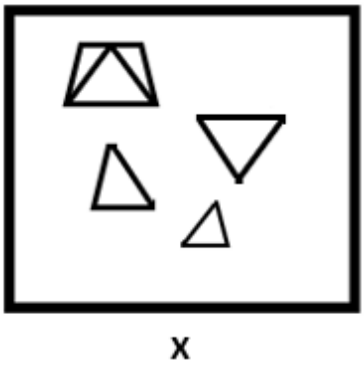 X 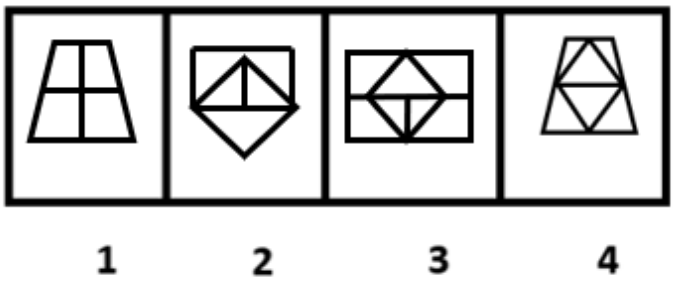 1 2 3 4
A	1
B	2
C	3
D	4
E	None of the above
Answer	D
Marks	1

Qno.	49
Question	Find the figure from the answer set **(1,2,3,4)** which will continue series given in the problem set **(A, B, C, D)** 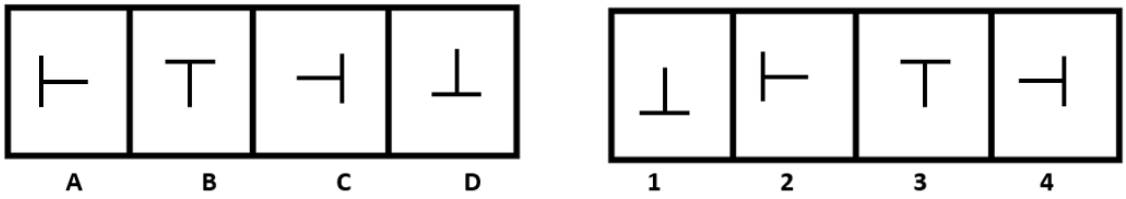
A	1
B	2
C	3
D	4
E	None of the above
Answer	B
Marks	1

Qno.	50
Question	Choose the correct option that will closely resemble the mirror image of the figure given below. 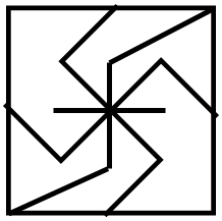 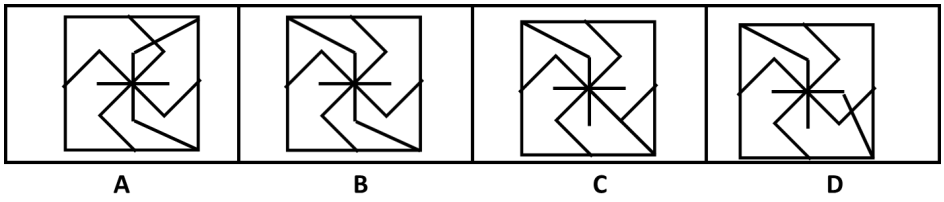 A B C D
A	A
B	B
C	C
D	D
E	None of the above
Answer	B
Marks	1

Date	22/11/2026
Exam Time	09:15 AM TO 10:30 AM
Qno.	41
Question	Identify the figure that completes the pattern 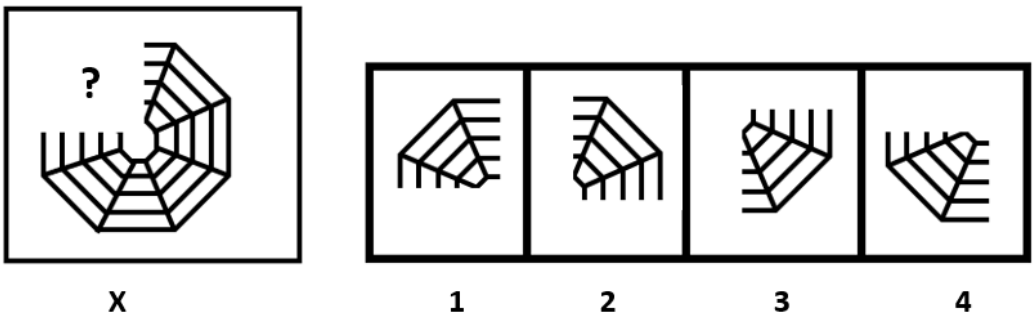
A	1
B	2
C	3
D	4
E	None of the above
Answer	A
Marks	1

Qno.	42
Question	Identify the option that will complete the figure given below  
A	A
B	B
C	C
D	D
E	None of the above
Answer	C
Marks	1

Qno.	43
Question	Find the minimum number of straight lines required to create the figure given in the following box. 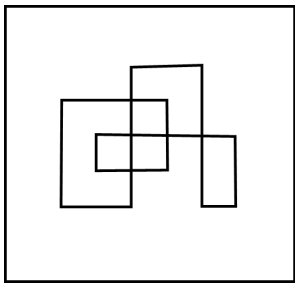
A	10
B	14
C	12
D	9
E	None of the above
Answer	C
Marks	1

Qno.	44
Question	Choose the figure that is different from the rest. 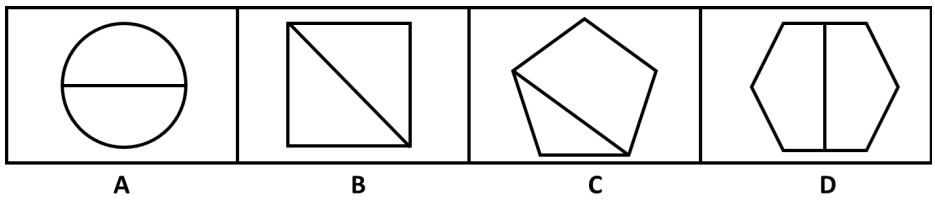
A	A
B	B
C	C
D	D
E	None of the above
Answer	C
Marks	1

Qno.	45
Question	Find the alternative figure which contains figure X as its part 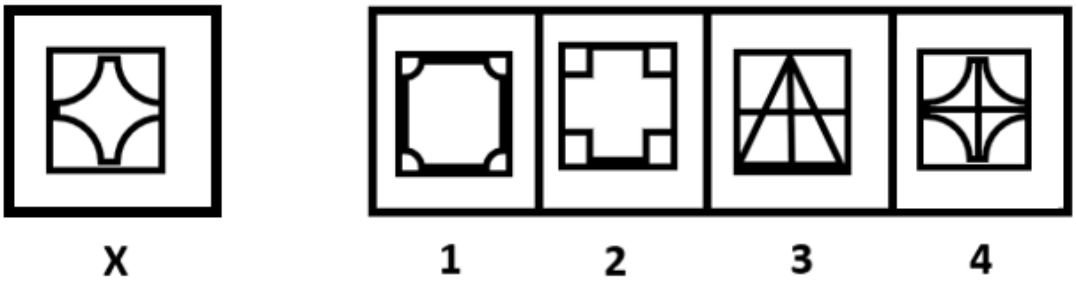
A	1
B	2
C	3
D	4
E	None of the above
Answer	D
Marks	1

Qno.	46
Questionl.	Group the given figure into three classes using each figure only once 
A	1,2,3;4,5,6;7,8,9
B	1,4,7;2,5,8;3,6,9
C	1,5,9;2,3,6;4,7,8
D	1,5,8;2,7,6;3,4,9
E	None of the above
Answer	D
Marks	1

Qno.	47
Question	Find out from amongst the four alternatives as to how the pattern would appear when the transparent sheet is folded at the dotted line in the direction of the arrow shown. 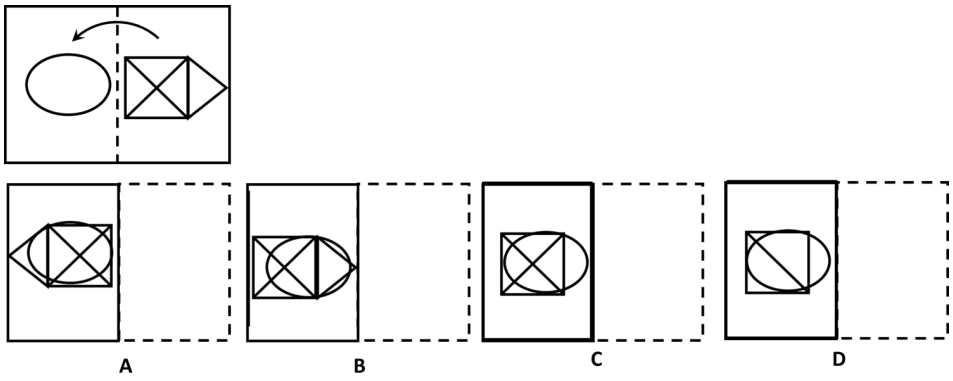
A	A
B	B
C	C
D	D
E	None of the above
Answer	A
Marks	1

Qno.	48
Question2.	Find out which of the following figures (1), (2), (3), (4) can be formed from the pieces given in the figure 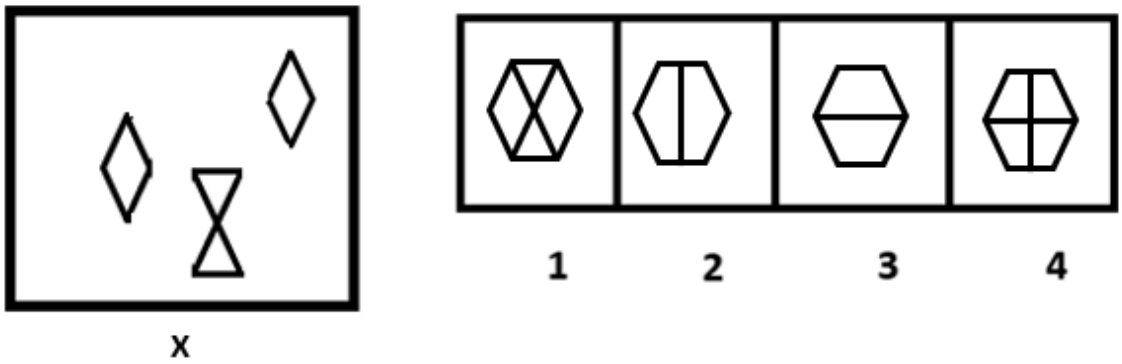
A	1
B	2
C	3
D	4
E	None of the above
Answer	A
Marks	1

Qno.	49
Question3.	Find the figure from the answer set **(1,2,3,4)** which will continue series given in the problem set **(A, B, C, D)** 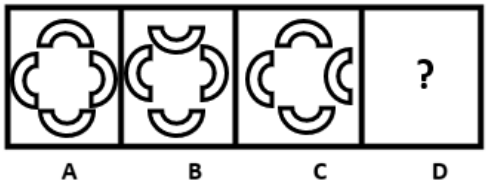 
A	1
B	2
C	3
D	4
E	None of the above
Answer	C
Marks	1

Qno.	50
Question	Choose the correct option that closely resembles the mirror image of the figure given below. **TSM1L9652** 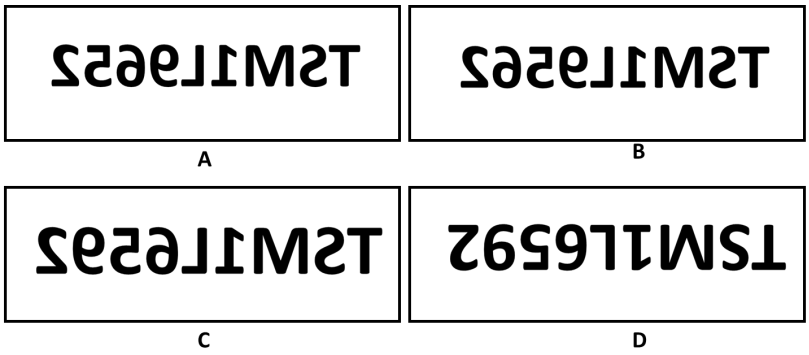 A B C D
A	A
B	B
C	C
D	D
E	None of the above
Answer	A
Marks	1

daa

Idid
Id
IdI

Date	22/11/2026
Exam Time	11:30 AM TO 12:45 PM
Qno.	41
Question	Select the correct option from the figures named as A, B, C, D that will continue the same series as established in the problem figure given below and will replace the question mark. 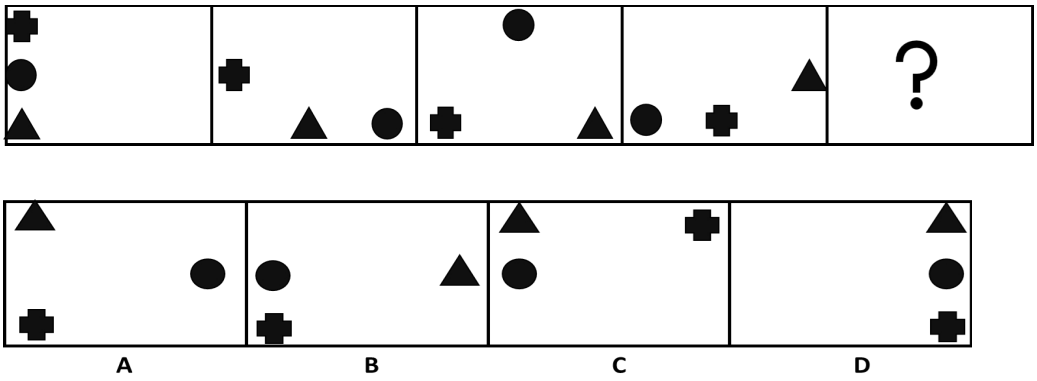
A	A
B	B
C	C
D	D
E	None of the above
Answer	D
Marks	1

Id	Qno.	42
	Question	Identify the option that will complete the figure given below. 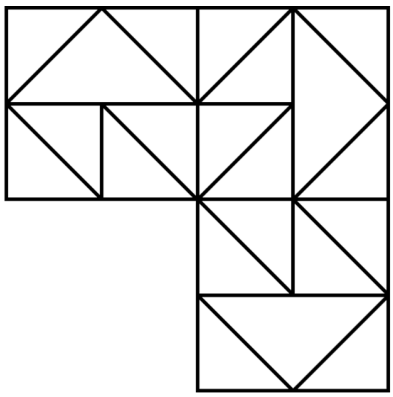 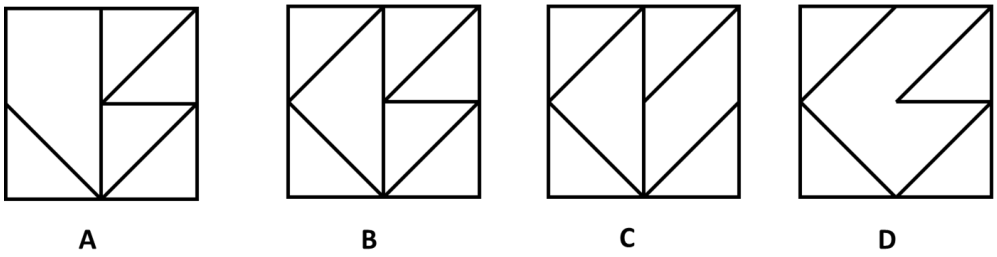
	A	A
	B	B
	C	C
	D	D
	E	None of the above
	Answer	B
	Marks	1

Id	Qno.	43
	Question	Find number of triangles in the given figure 
	A	5
	B	7
	C	8
	D	12
	E	None of the above
	Answer	E
	Marks	1

Id	Qno.	44
	Question1.	Choose the figure which is different from the rest 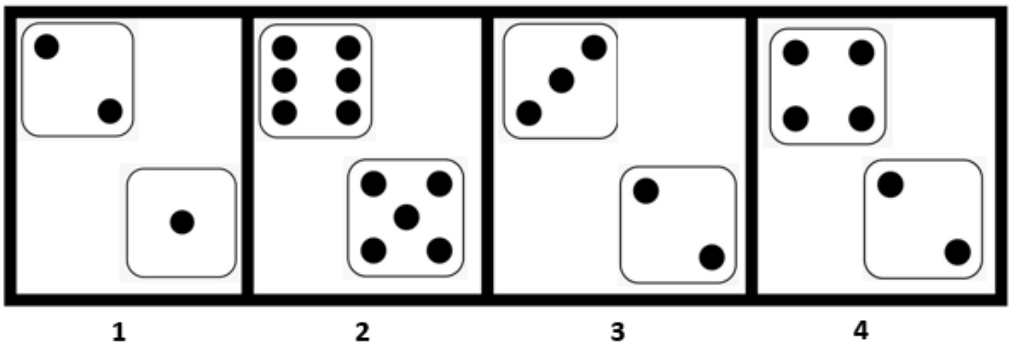
	A	1
	B	2
	C	3
	D	4
	E	None of the above
	Answer	D
	Marks	1

Id	Qno.	45
	Question	Find the alternative figure which contains figure X as its part 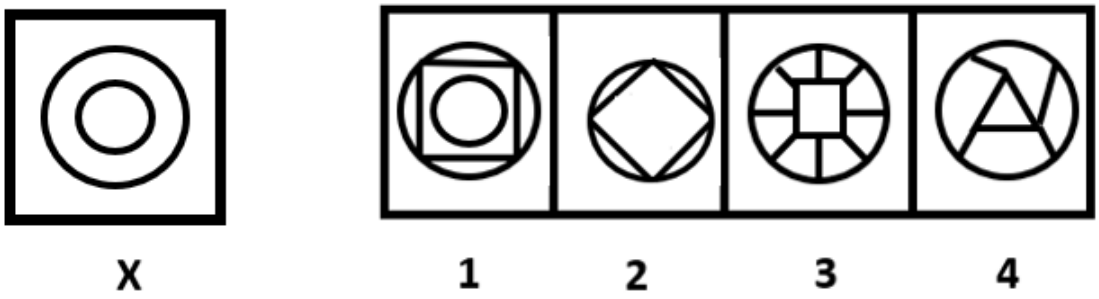
	A	1
	B	2
	C	3
	D	4
	E	None of the above
	Answer	A
	Marks	1

Id	Qno.	46
	Question	Group the given figures into three classes using each figure only once. 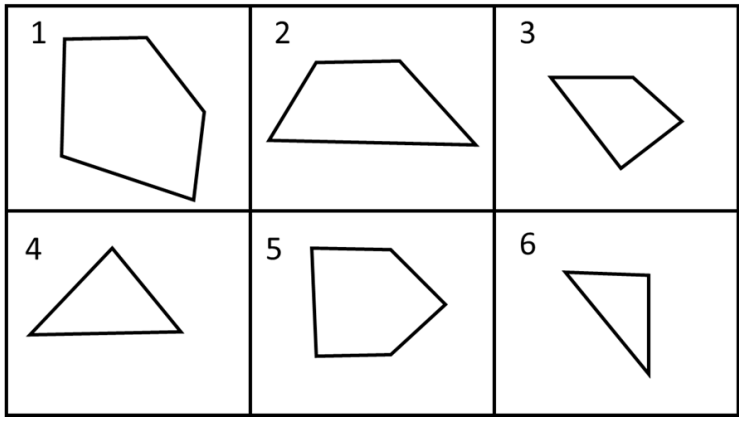
	A	(1,5), (2,3), (4,6)
	B	(4,6), (1,3), (5,2)
	C	(1,5), (6,2), (3,4)
	D	(1,2), (3,5), (4,6)
	E	None of the above
	Answer	A
	Marks	1

Id	Qno.	47
	Question	A square sheet of paper is folded and cut as shown below. Which figure will appear when it is opened? 
	A	
	B	
	C	
	D	
	E	None of the above
	Answer	C
	Marks	1

Id	Qno.	48
	Question	Select the alternative which represents three out of the five alternative figures which when fitted into each other would form a complete Triangle.. 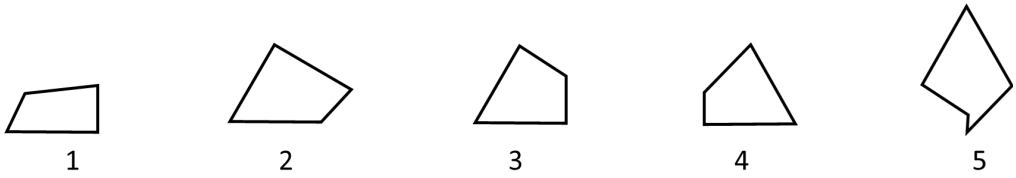
	A	5, 1, 4
	B	3, 4, 5
	C	3, 1, 5
	D	1, 2, 5
	E	None of the above
	Answer	B
	Marks	1

Id	Qno.	49
	Question2.	The question below consists of two set of figures. Figures A,B,C,D constitutes problem set while figures 1,2,3,4 constitute answer set . There is definite relationship between figures A and B. Establish a suitable relationship between figures C and D by Selecting a suitable figure from the Answer Figures that would replace the question mark (?). 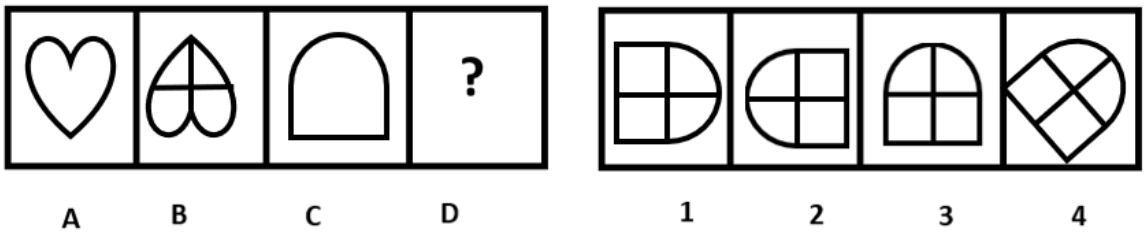
	A	1
	B	2
	C	3
	D	4
	E	None of the above
	Answer	E
	Marks	1

Id	Qno.	50
	Question	Choose the correct option that closely resembles the water image of the following figure. 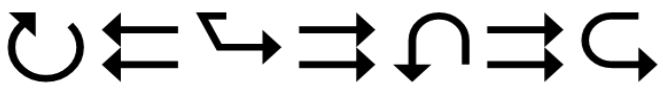 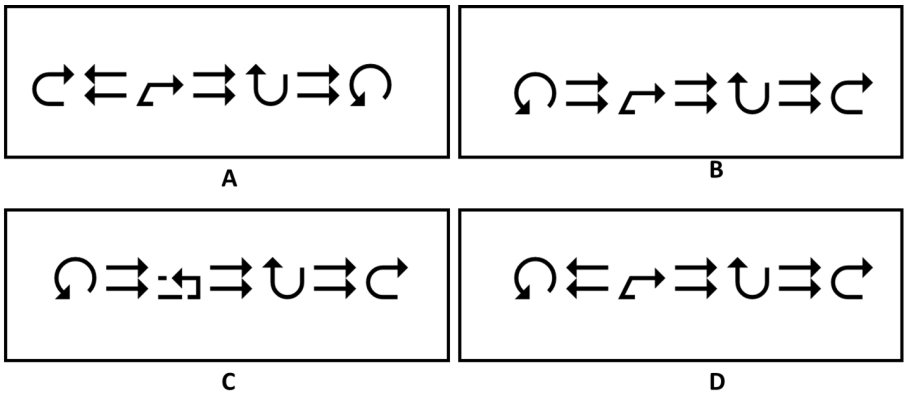
	A	A
	B	B
	C	C
	D	D
	E	None of the above
	Answer	D
	Marks	1

Date	22/11/2026
Exam Time	02:00 PM TO 03:15 PM
Qno.	41
Questionl.	Identify the figure that completes the pattern 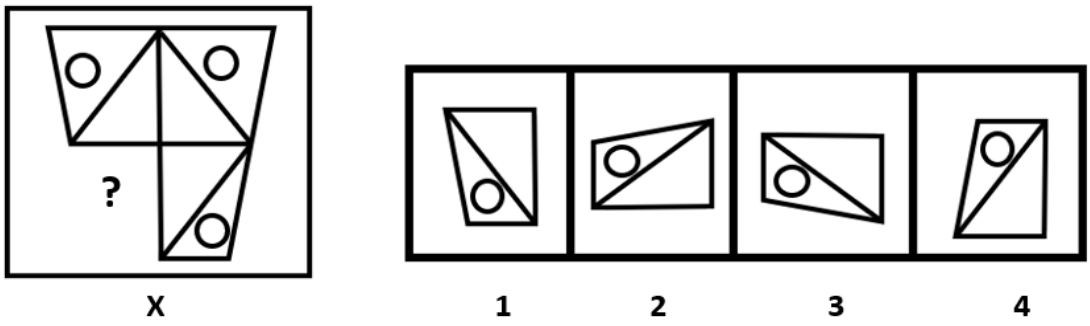
A	1
B	2
C	3
D	4
E	None of the above
Answer	A
Marks	1

Qno.	42
Question	Identify the option that will complete the figure given below. 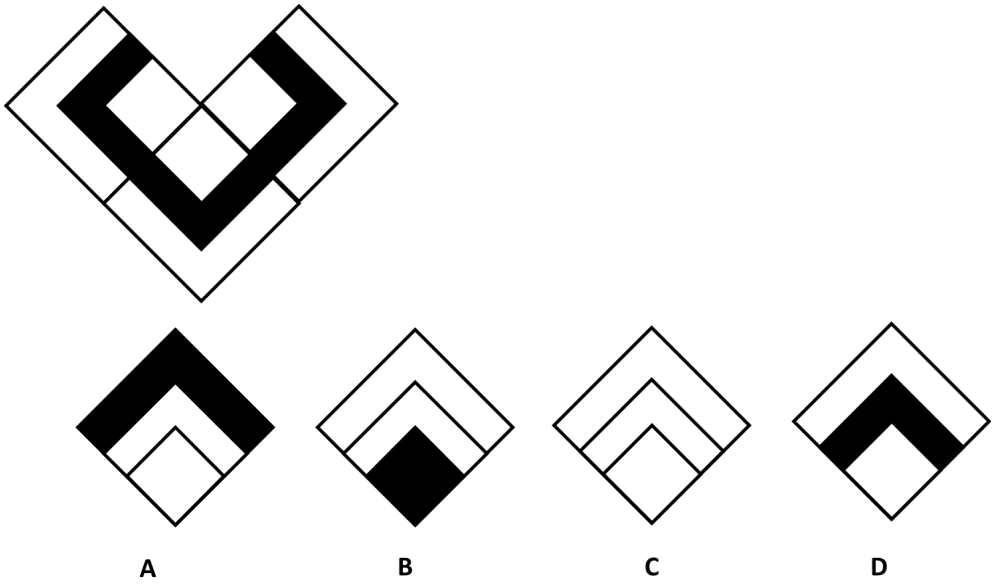
A	A
B	B
C	C
D	D
E	None of the above
Answer	D
Marks	1

Qno.	43
Question2.	Find the number of quadrilaterals and triangles present in the figure given below 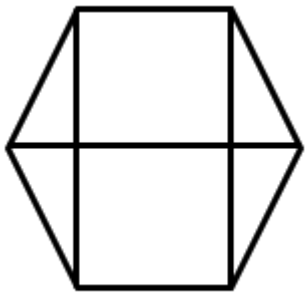
A	2,3
B	2,4
C	2,5
D	3,4
E	None of the above
Answer	D
Marks	1

Qno.	44
Question3.	Choose the figure which is different from the rest 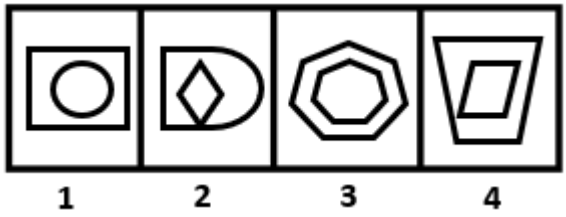
A	1
B	2
C	3
D	4
E	None of the above
Answer	C
Marks	1

Qno.	45
Question	Find the alternative figure which contains figure X as its part 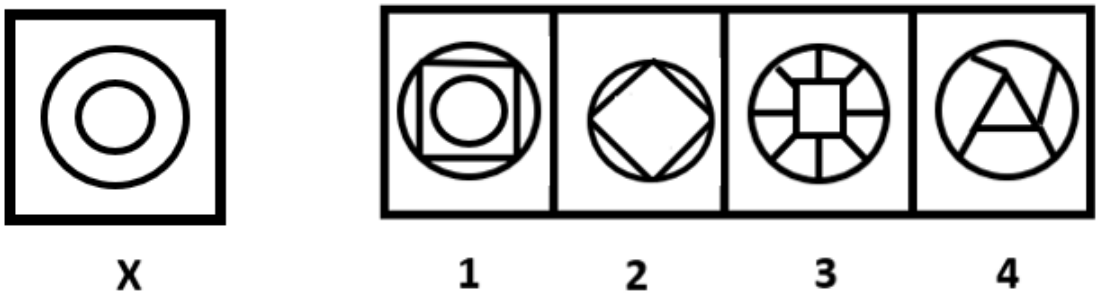
A	1
B	2
C	3
D	4
E	None of the above
Answer	A
Marks	1

Qno.	46
Question	Group the given figure into three classes using each figure only once 
A	1,6,7; 2,4,8;3,5,9
B	1,2,3;4,5,6;7,8,9
C	1,4,7;2,5,8;3,6,9
D	1,5,9;2,3,6;4,7,8
E	None of the above
Answer	A
Marks	1

Qno.	47
Question	Which of the figures labeled A, B, C, or D will be the result when the transparent sheet shown below is folded along the dotted line? 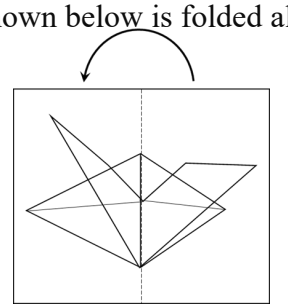 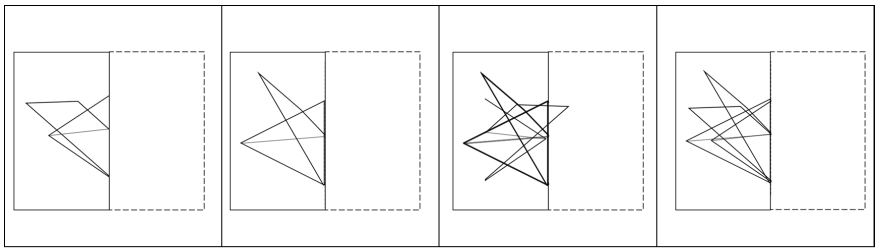 A B C D
A	A
B	B
C	C
D	D
E	None of the above
Answer	D
Marks	1

Qno.	48
Question	Find out which of the figures (1), (2), (3) and (4) can be formed from the pieces given in figure (X). 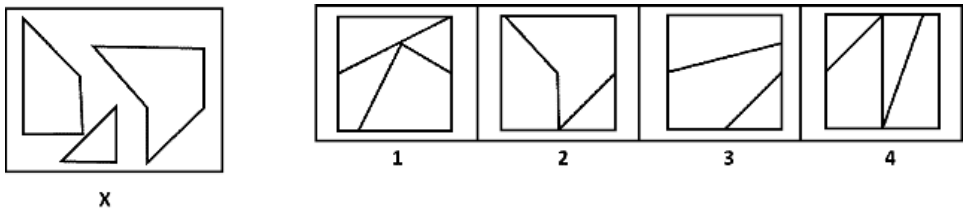
A	1
B	2
C	3
D	4
E	None of the above
Answer	B
Marks	1

Qno.	49
Question	The question below consists of two set of figures. Figures A,B,C,D constitutes problem set while figures 1,2,3,4 constitute answer set . There is definite relationship between figures A and B. Establish a suitable relationship between figures C and D by Selecting a suitable figure from the Answer Figures that would replace the question mark (?). 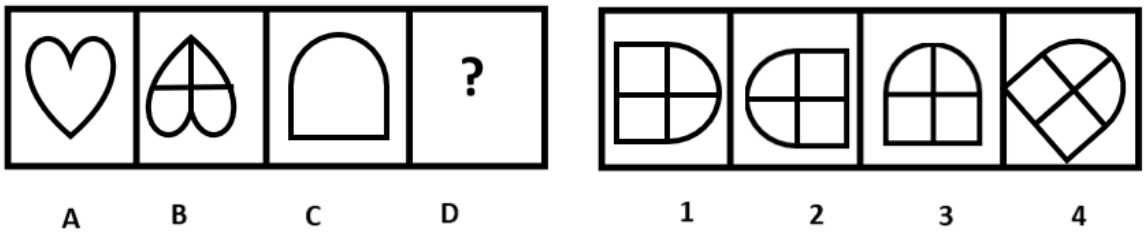
A	1
B	2
C	3
D	4
E	None of the above
Answer	E
Marks	1

Qno.	50
Question	Choose the correct option that closely resembles the mirror image of the figure given below 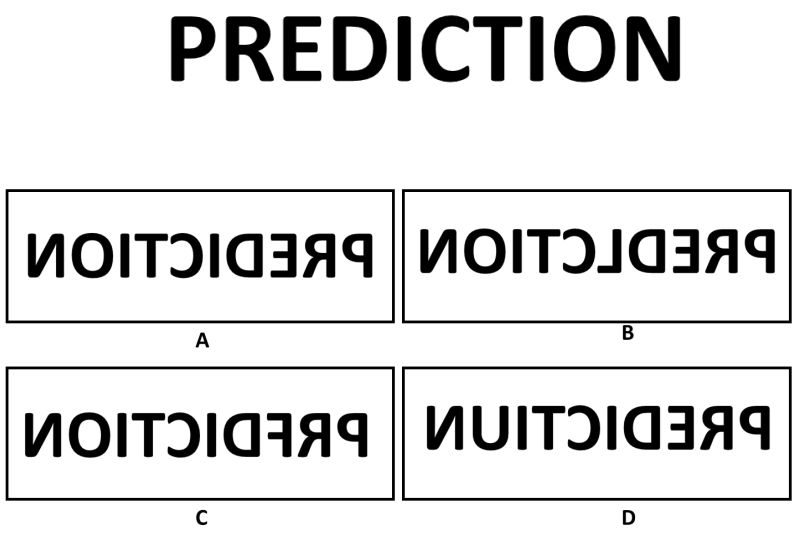
A	A
B	B
C	C
D	D
E	None of the above
Answer	A
Marks	1

Date	22/11/2026
Exam Time	04:15 PM TO 05:30 PM
Qno.	41
Questionl.	Identify the figure that completes the pattern 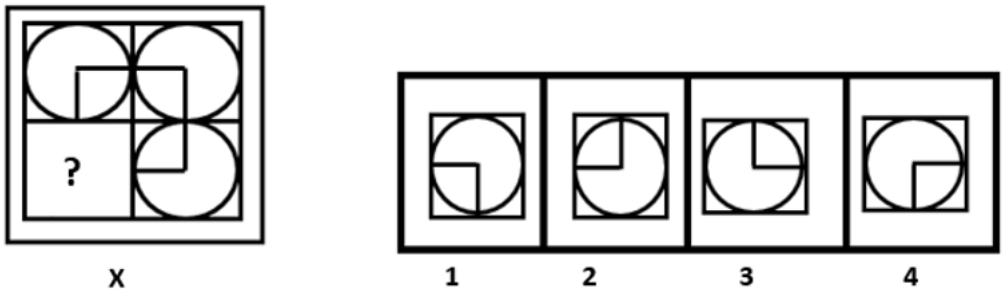
A	1
B	2
C	3
D	4
E	None of the above
Answer	C
Marks	1

Qno.	42
Question	Find out from the four alternatives, how the pattern would appear when the transparent sheet is folded at the dotted line in the direction of the arrow shown. 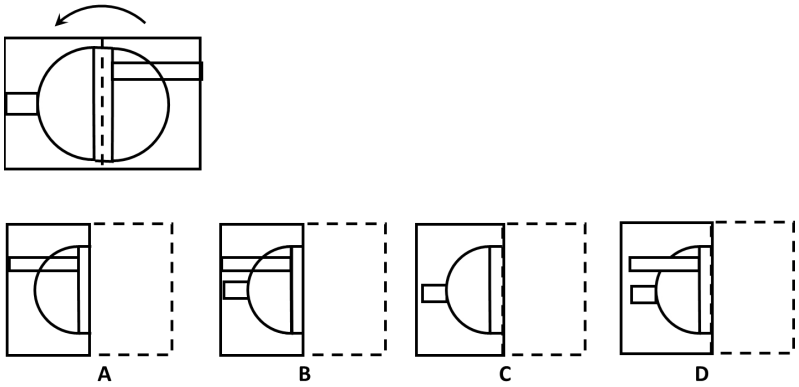
A	A
B	B
C	C
D	D
E	None of the above
Answer	B
Marks	1

Qno.	43
Question	How many straight lines are there in the figure? 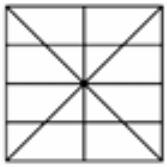
A	6
B	8
C	10
D	12
E	None of the above
Answer	C
Marks	1

Qno.	44
Question2.	Choose the figure which is different from the rest 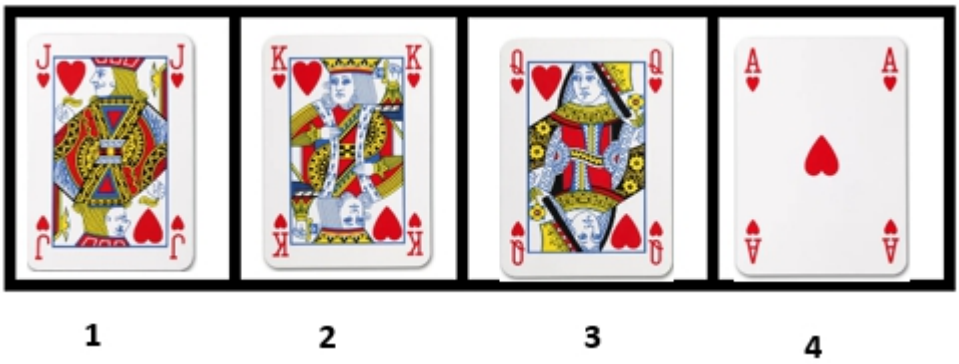
A	1
B	2
C	3
D	4
E	None of the above
Answer	D
Marks	1

Qno.	45
Question	From the alternative figures 1, 2, 3 and 4 which figure contains figure X as its part? 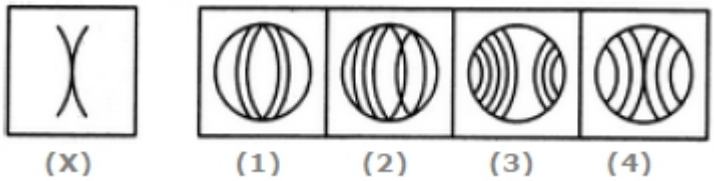
A	1
B	2
C	3
D	4
E	None of the above
Answer	D
Marks	1

Qno.	46
Question3.	Group the given figure into three classes using each figure only once 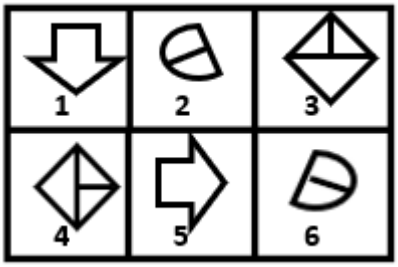
A	1,2;2;3,3;4
B	1,3;2;4,5;6
C	1,5;2,6;3,4
D	1,6;2,3;4,5
E	None of the above
Answer	C
Marks	1

Qno.	47
Question	Choose a figure which would most closely resemble the unfolded form of Figure (Y). 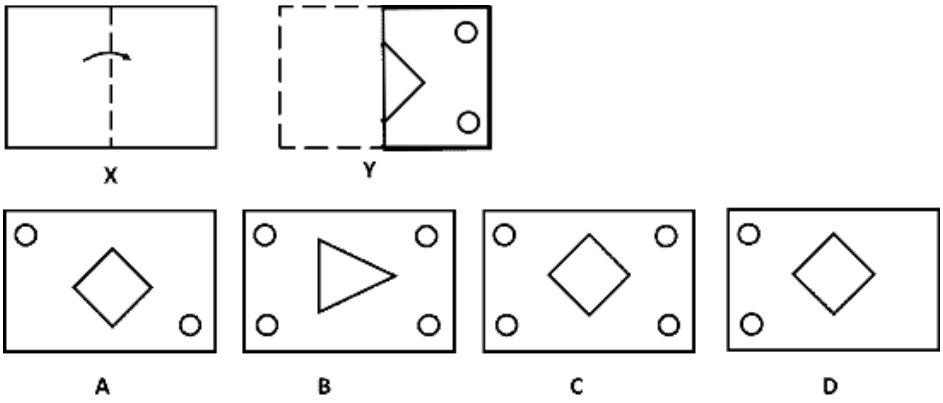
A	A
B	B
C	C
D	D
E	None of the above
Answer	C
Marks	1

Qno.	48
Question	Select the alternative which represents three out of the five alternative figures which when fitted into each other would form a complete Triangle.. 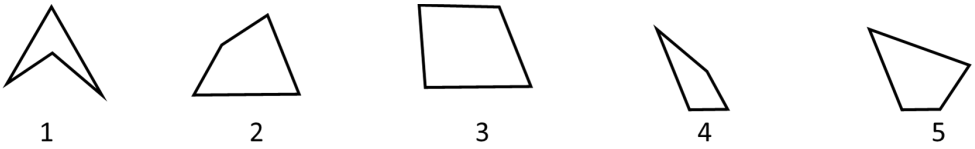 1 2 3 4 5
A	2, 3, 4
B	1, 4, 5
C	2, 4, 5
D	1, 2, 4
E	None of the above
Answer	D
Marks	1

Qno.	49
Question.	The question below consists of two set of figures. Figures A,B,C,D constitutes problem set while figures 1,2,3,4 constitute answer set . There is definite relationship between figures A and B. Establish a suitable relationship between figures C and D by Selecting a suitable figure from the Answer Figures that would replace the question mark (?). 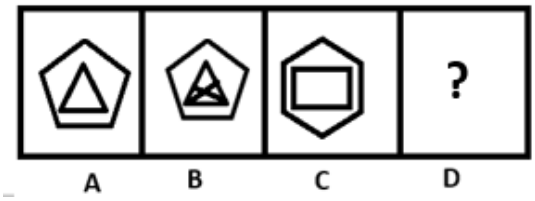 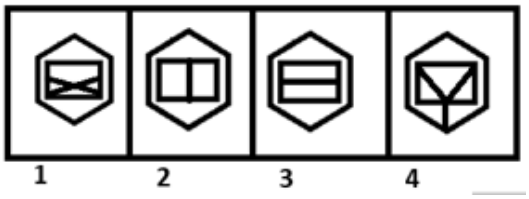
A	1
B	2
C	3
D	4
E	None of the above
Answer	A
Marks	1

Qno.	50
Question	Choose the correct option that closely resembles the water image of the following figure. 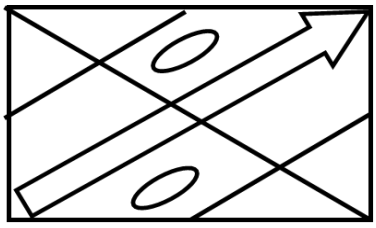 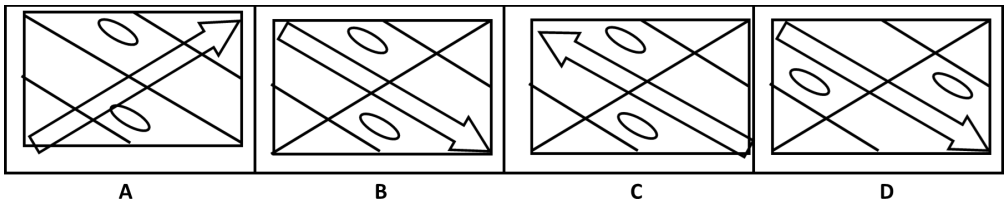
A	A
B	B
C	C
D	D
E	None of the above
Answer	B
Marks	1